Name Date

AREA SHEET 3

Work out the area of the following rectangles. They are not to scale.

1)

Area = _____ square cm

2)

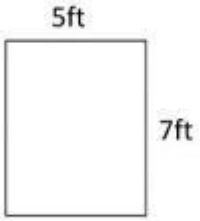

Area = _____ square ft

3)

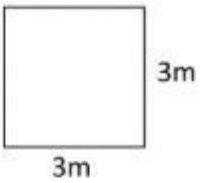

Area = _____ square m

4)

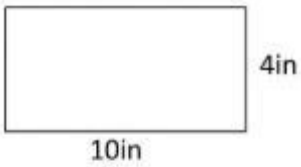

Area = _____ square in

5)



Area = _____ square m

6)

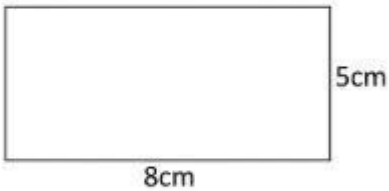

Area = _____ square cm

LIVEWORKSHEETS