Name:_____

Counting tens and ones

Find the total number of blocks.

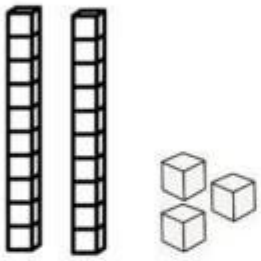

= 2 tens+ 3 ones = 23

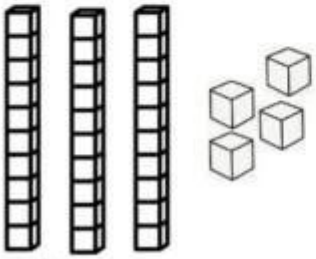

= _____tens+_____ones = _____

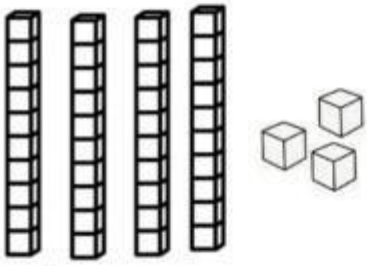

= _____tens+_____ones = _____

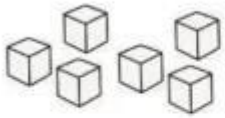

= _____tens+_____ones = _____

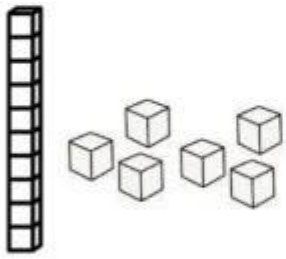

= _____tens+_____ones = _____

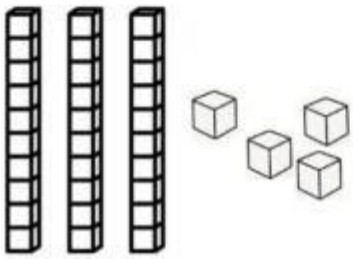

= _____tens+_____ones = _____

LIVEWORKSHEETS