Questions on Hundreds

Move the image into place. Count the number of items below according to their units.

Example:

1 Hundreds : bolt = 200

car

Tens : = 50

screwdriver

Unit: = 6

TOTAL : 256

2 Blue Flower

Hundreds : =

Pink Flower

Tens : =

Yellow Flower

Unit: =

TOTAL :



LIVEWORKSHEETS

Questions on Hundreds

Move the image into place. Count the number of items below according to their units.

3

Pink bird
Hundreds : =

Blue bird
Tens : =

Owl
Unit: =

TOTAL :



4

clown fish
Hundreds : =

yellow fish
Tens : =

Stingray
Unit: =

TOTAL :



LIVEWORKSHEETS

Questions on Hundreds

Move the image into place. Count the number of items below according to their units.

5

Star
Hundreds : =

Crescent moon
Tens : =

full moon
Unit: =

TOTAL :



6

plate
Hundreds : =

spoon
Tens : =

fork
Unit: =

TOTAL :

LIVEWORKSHEETS