Name: _____

Metric Liquid Volume

Directions: Label the diagram with the proper liquid measures.

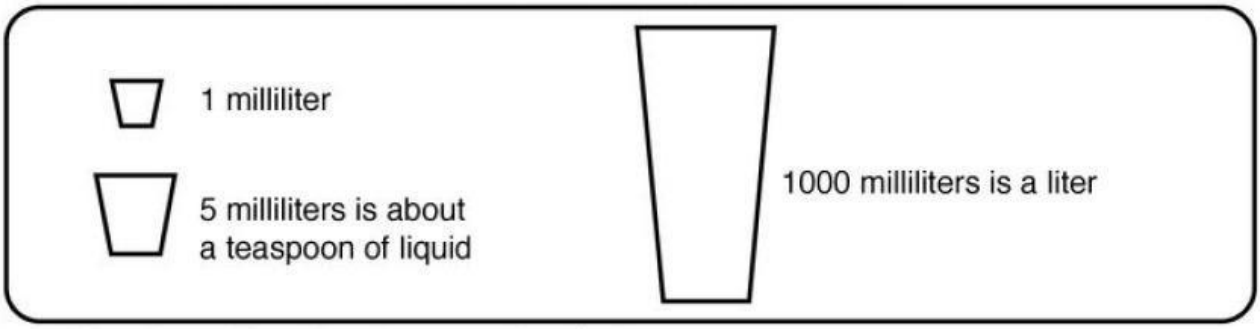

Directions: Complete the conversions below.

1. 1 liter = _____ milliliters
2. 5000 ml = _____ liters
3. 4 liters = _____ milliliters
4. 9,000 ml = _____ liters
5. 11 liters = _____ milliliters

Directions: Compare the measures below.

6. 2 liters _____ 50 milliliters
7. 5000 ml _____ 5 liters
8. 15 liters _____ 20,000 ml
9. 1 liter _____ 100 ml
10. 1500 ml _____ 2 liters

Label the liter container using milliliter segments. Fill the container with red liquid up to 550 milliliters.

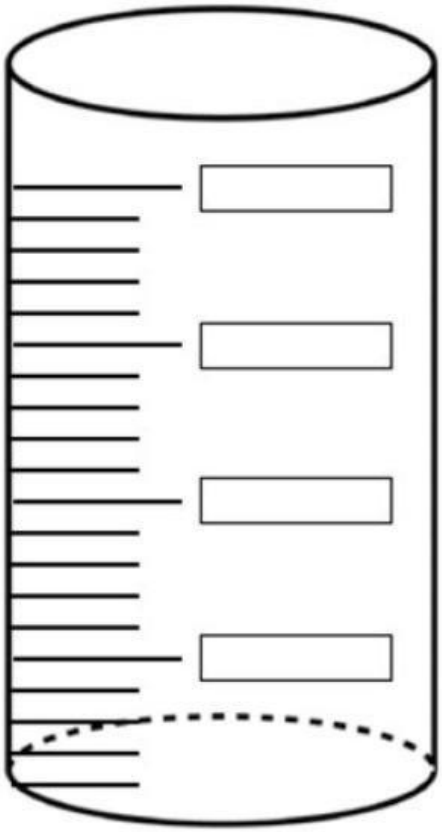

© www.HaveFunTeaching.com

LIVEWORKSHEETS

Exercise 7 Liters and Milliliters

1. Match.

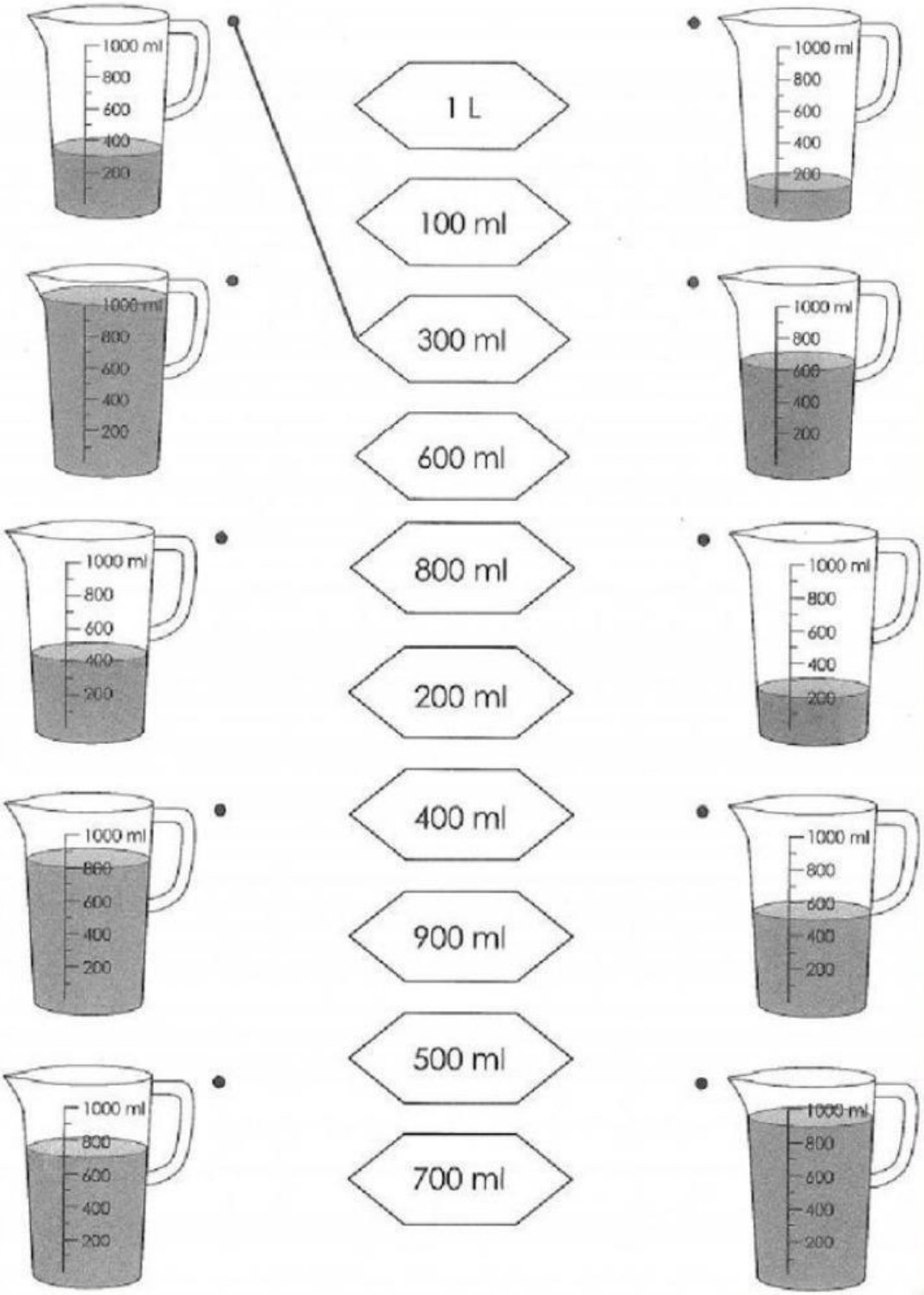

LIVEWORKSHEETS