LEMBAR KERJA PESERTA DIDIK

BELAJAR SUDUT MELALUI PENGAMATAN GAMBAR

PETUNJUK:

1. AMATI GAMBAR SUDUT.
2. UKUR BESAR SUDUT.
3. TENTUKAN JENIS SUDUT.

KELOMPOK VISUAL

LIVEWORKSHEETS

2. Bentuk sudut

AMATILAH VIDEO BERIKUT

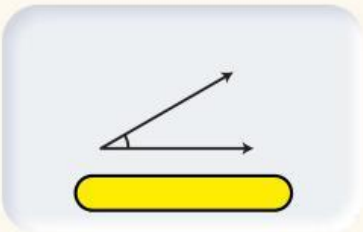

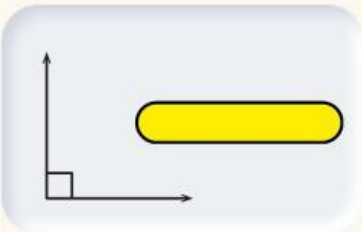

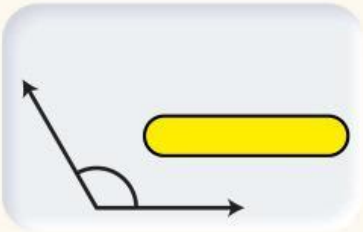

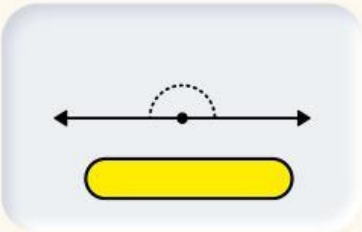

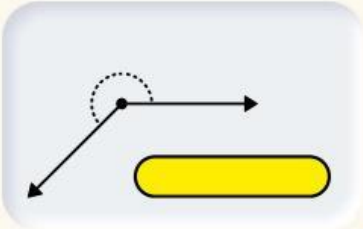

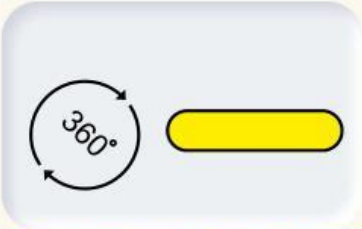



LIVEWORKSHEETS

TABEL PENGAMATAN

GAMBAR SUDUT A

Besar Sudut :

Jenis Sudut :

GAMBAR SUDUT B

Besar Sudut :

Jenis Sudut :

GAMBAR SUDUT C

Besar Sudut :

Jenis Sudut :

GAMBAR SUDUT D

Besar Sudut :

Jenis Sudut :

LIVEWORKSHEETS

TUGAS DISKUSI

1) Sudut manakah yang paling besar?

2) Sudut manakah yang termasuk sudut siku-siku?

3) Apa perbedaan sudut lancip dan sudut tumpul?

Kesimpulan tentang sudut yang kamu pelajari :

LIVEWORKSHEETS