Mid-Plenary

2 How much money in pounds is there in each box?

A

C

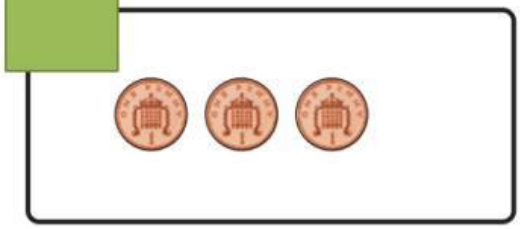

B

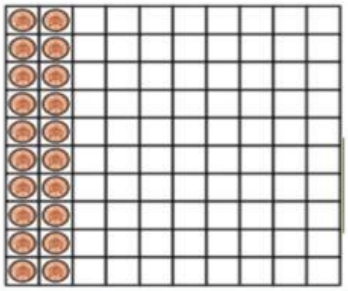



Key 1p 2p 5p 10p 20p 50p £1 £2

LIVEWORKSHEETS