LEMBAR KERJA PESERTA DIDIK

LKPD

MATEMATIKA

NAMA :

KELAS :

LIVEWORKSHEETS

Mecocokkan Bangun Datar

Pasangkan Bentuk dan Namanya

Lingkaran

Persegi

Segi lima

Segi tujuh

Trapesium

Segitiga

LIVEWORKSHEETS



Mengenal Bangun Datar

Tulislah nama bangun datar sesuai gambar di bawa ini!

LIVEWORKSHEETS

Mencocokkan Bentuk

Tariklah garis gambar bangun datar yang memilik bentuk sama



LIVEWORKSHEETS

Mengenal Bangun Datar Persegi



Persegi

Pilihlah gambar persegi dibawah ini!



LIVEWORKSHEETS

MENGENAL BANGUN DATAR

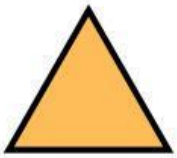

segitiga

Pilihlah gambar yang berbentuk segitiga:

LIVEWORKSHEETS

CIRI & SIFAT BANGUN DATAR

Cermati gambar dibawah kemudian tarik garis dan pasangkan dengan pernyataan yang benar!

- Memiliki 4 sisi sama panjang
- 4 sudut siku-siku yang sama besar

- Memiliki 4 sisi, kedua sisi yang saling berhadapan sama panjang dan sejajar

- Memiliki satu titik pusat
- Jumlah derajat sebesar 360 derajat

- Memiliki 3 sisi yang sama panjang
- Memiliki 3 sudut yang sama besar

- Memiliki 6 sisi yang sama panjang
- Memiliki 6 sudut yang sama besar

LIVEWORKSHEETS

Nama : .....

Kelas : .....

Bangun Datar

Tuliskan nama bangun sesuai nomor yang diberikan.

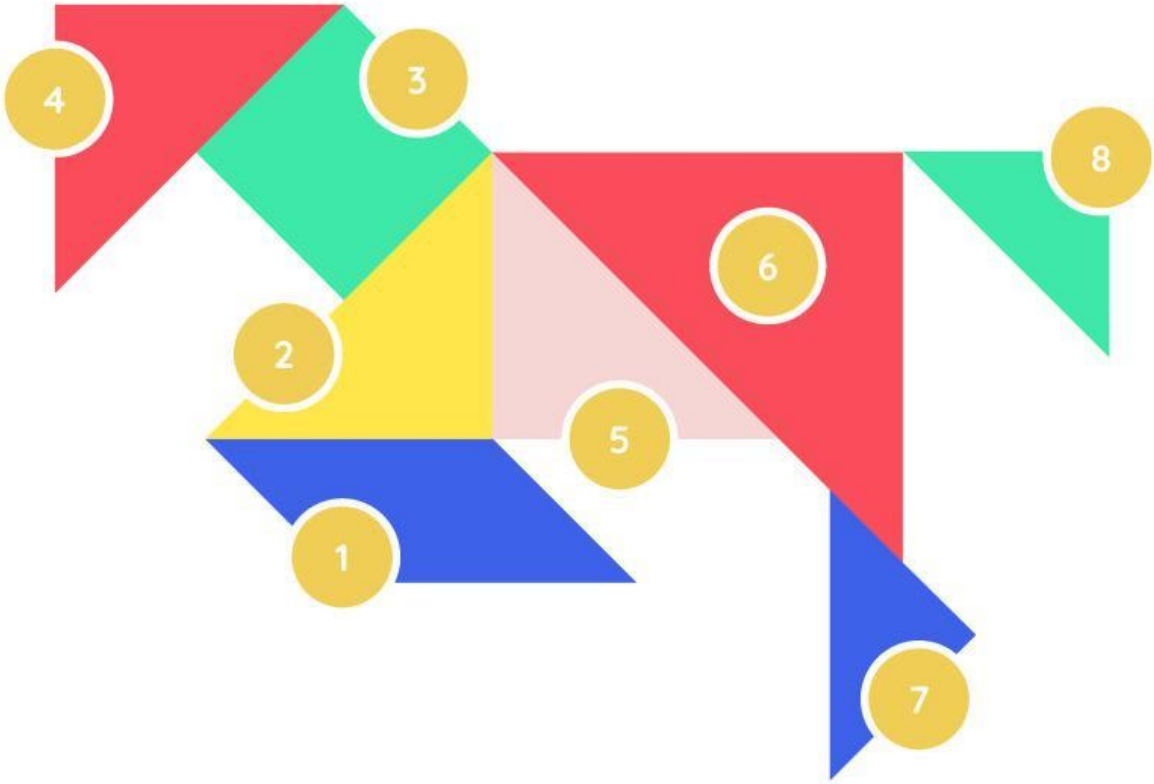

1 .....

2 .....

3 .....

4 .....

5 .....

6 .....

7 .....

8 .....

LIVEWORKSHEETS

Nama : Kelas :

DEKOMPOSISI BANGUN DATAR

Amati susunan bangun datar di bawah ini kemudian tentukan komposisi bangun datar dari susunan tersebut!

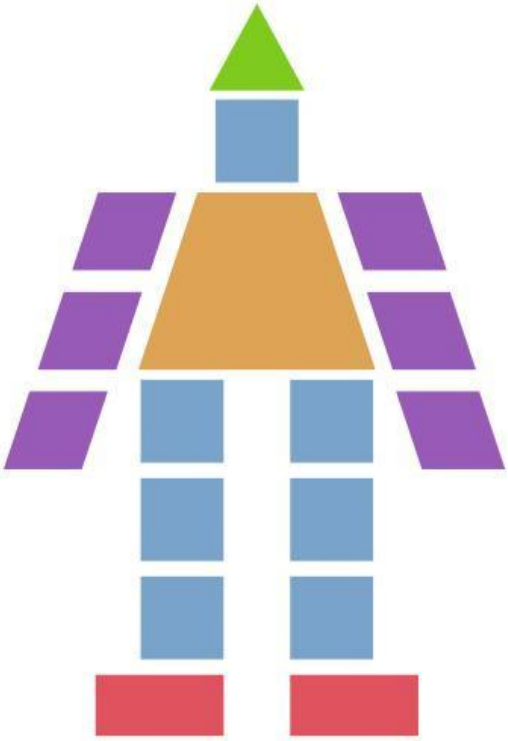

Bentuk Bangun	Nama Bangun	Jumlah Bangun

LIVEWORKSHEETS

Kelas :

Keliling dan Luas Bangun Datar

Hitunglah keliling dan luas bangun datar di bawah dengan benar!

Bangun Datar	Nama Jenis	Keliling	Luas
 12 cm			
15 cm 7cm			
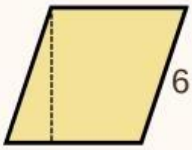 6 cm 10 cm			
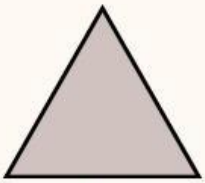 6 cm			
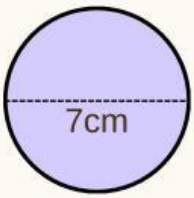 7cm			

LIVEWORKSHEETS

GARIS SEJAJAR & TEGAK LURUS

Tentukanlah garis-garis di bawah ini dengan benar!

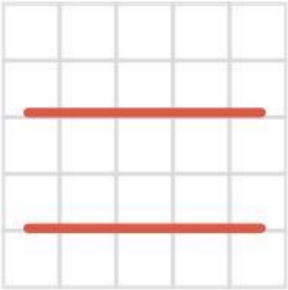

Garis :

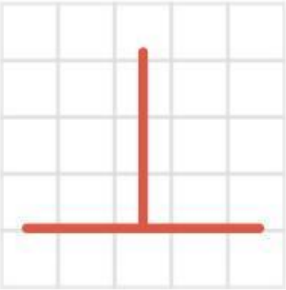

Garis :

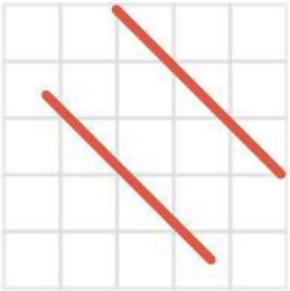

Garis :



Garis :

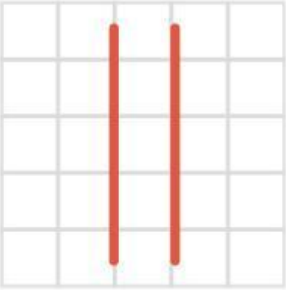

Garis :

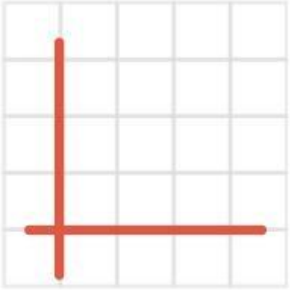

Garis :

Garis :



Garis :

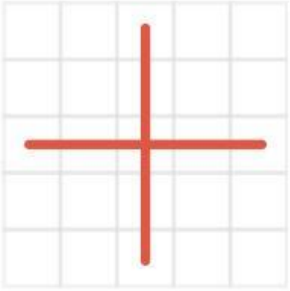

Garis :

LIVEWORKSHEETS