Grade 12 GEN

Mathematics

Module-8- 2025-2026

وزارة التربية و التعليم

Trigonometric Functions

Term-3

MR Rachid K

Lesson 9-1
Angles and Angle Measure

Find the length of each arc.

Drag and Drop

1.

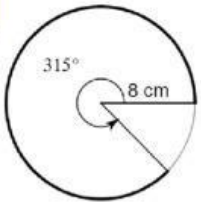

2-

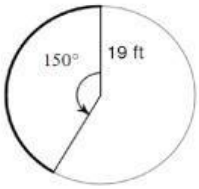

3-

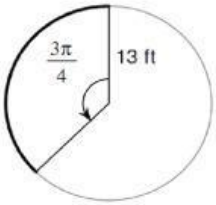

4-

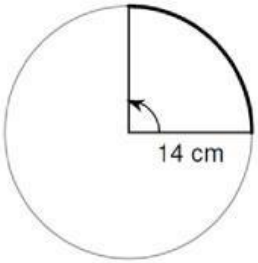

5-

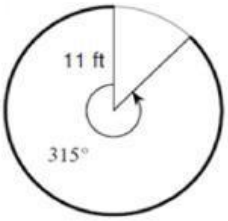

7π cm

$\frac{95\pi}{6}$ ft

14π cm

$\frac{39\pi}{4}$ ft

60.5 ft

K-RACHID

LIVEWORKSHEETS