التحقق من فهمك

جـــد قياس كل مما يلي.

14. AB

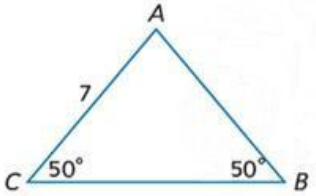

15. HG

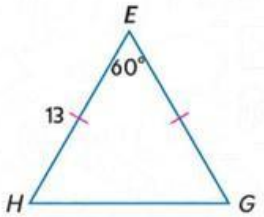

16. $m\angle NMP$

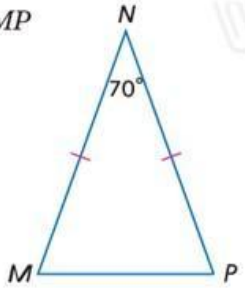

17. $m\angle RST$

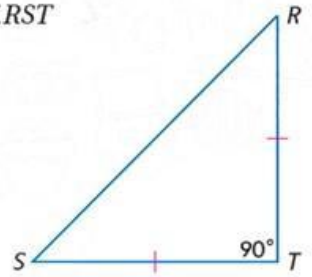

LIVEWORKSHEETS