IEG SCHOOL PARTNER

Name: ..... **Class:** .....

MOCK TEST

Time allowance: 35 minutes

1. Read the description. Write the correct word. There is one extra word.

balanced	pull	soil	diet	magnetism

M	W	L	A	N	C	E	D	Y	B
X	A	Q	Z	V	M	J	I	S	A
T	U	G	I	D	T	W	E	O	L
H	L	B	N	Q	A	X	D	I	A
M	L	K	F	E	G	N	E	L	N
A	Z	S	O	I	T	V	T	W	C
G	R	D	W	S	O	I	L	X	E
E	E	I	I	C	Y	H	S	K	D
N	V	E	P	U	L	L	Z	M	Q
T	X	T	J	W	R	N	A	B	S

a. ..... : containing the right amount of foods from all groups.

b. ..... : the force of a magnet.

c. ..... : the foods and drinks we often eat.

d. ..... : special mixture of small pieces of rock and humus.

e. ..... : to move an object towards you.

2. Choose the correct answer.

a. Push and pull can change an object's ....

A. mass

B. shape

C. weight

LIVEWORKSHEETS

b. An example of a *pull* is …….. .

A. opening a drawer B. throwing a ball C. pressing a button

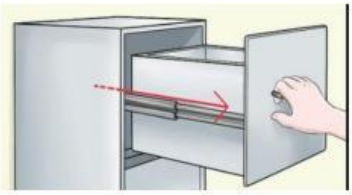

c. …… rocks let water move through.

A. Sedimentary

B. Metamorphic

C. Igneous

d. Which of the following objects is non-magnetic?

A. Paper cup

B. Steel scissors

C. Iron key

e. …….. is the force that gives us grips and slows things down.

A. Magnetism

B. Pull

C. Friction

f. These two magnets will … .

A. attract each other
B. repel each other
C. change each other's shape



3. Read the statements. Choose True or False.

a. We need to eat only fat to help us live and grow. **True** **False**

b. Smooth surfaces create less friction. **True** **False**

c. Fossils form when living things die and become trapped in rock. **True False**

d. Opposite poles of magnets repel each other. **True** **False**

LIVEWORKSHEETS

e. Sedimentary rocks form when hot liquid rock cools down. **True** **False**

5. Look at the pictures. Check (✓) the food groups in each meal. Sort the foods into the correct groups.

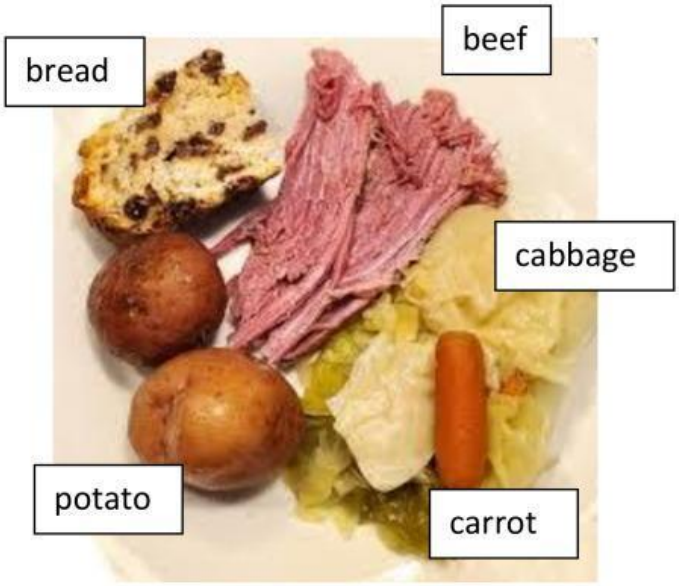

☐ Carbohydrates: .....

☐ Proteins: .....

☐ Fats and oils: .....

☐ Vitamins and minerals: .....

☐ Carbohydrates: .....

☐ Proteins: .....

☐ Fats and oils: .....

☐ Vitamins and minerals: .....

6. Choose the correct word to complete the sentence.

a. **Vitamins and minerals** / **Proteins** help us build muscles.

b. A **push / pull** moves the object toward you.

c. **Loam / Chalky** soil is a good mixture of sand, clay and humus.

d. We need **different / one** type(s) of food to keep us alive and grow.

LIVEWORKSHEETS

6. Roy finds this label on a packet of food.

Is this food a healthy choice? Explain.

This food is ..... because it

contains .....

.....

.....

HIGH	Fat 24.0g per serving
HIGH	Saturates 10.5g per serving
MED	Sugars 7.2g per serving
HIGH	Salt 2.8g per serving
	490 Calories per serving

7. Daisy uses a magnet to attract paper clips.

This magnet only attracts five paper clips. The other clips are not attracted.

What materials might the other clips be made of?

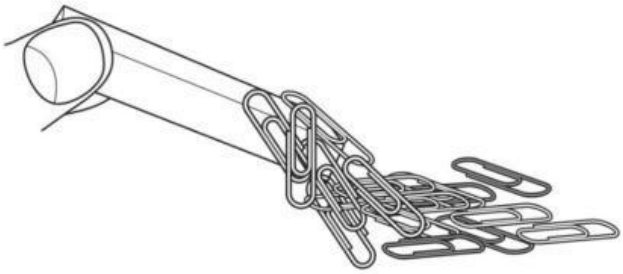

.....

LIVEWORKSHEETS