صل كل متباينة بالتمثيل البياني الصحيح.

التمثيل البياني	المتباينة
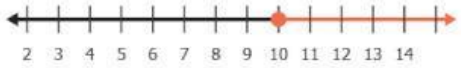	$x > 10$
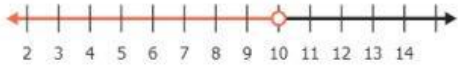	$x \leq 10$
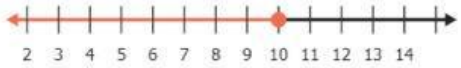	$x < 10$
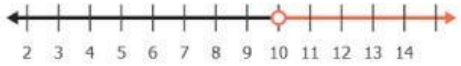	$x \geq 10$

LIVEWORKSHEETS