On My Own

Name _____

What is the sum? Use the open number line.

1. 27 + 4 = ____

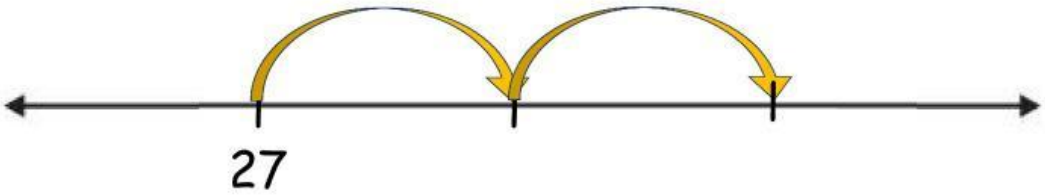

2. 45 + 8 = ____

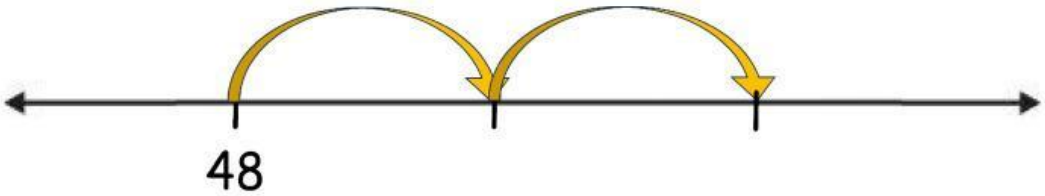

What is the sum?

3. 9 + 62 = ____

4. 36 + 7 = ____

5. 59 + 5 = ____

6. 6 + 74 = ____

Copyright © McGraw-Hill Education

LIVEWORKSHEETS

7. Maria has 37 round beads. She has 9 long beads. How many beads does Maria have?

_____ beads

8. **Error Analysis** Enzo adds 9 + 23.

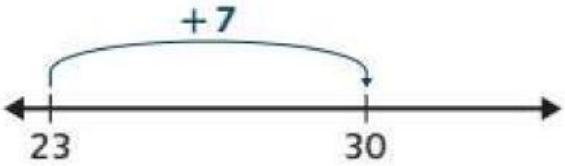

He says the sum is 30. Do you agree? Explain.

9. **Extend Your Thinking** Kia has 26 buttons. She buys 7 more. How can you find how many buttons?

Reflect

How can you use an open number line to add ones to a number?

Math is... Mindset

How have you worked to reach your goal today?

Copyright © McGraw-Hill Education

LIVEWORKSHEETS