Visual Learning Bridge

Count 23 cubes.

You can make groups of 10.

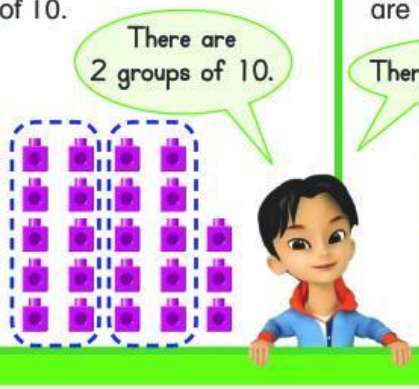

Count how many ones are left over.



23 is 2 groups of 10 and 3 ones.

Convince Me! Why does 37 have 3 groups of 10 and not 4 groups of 10?

Guided Practice

Circle groups of 10. Write the numbers.

1. 

2 groups of 10 and 7 ones is 27.

2.

_____ groups of 10 and _____ ones is _____.

© by Savvas Learning Company LLC.

LIVEWORKSHEETS

Name _____

Independent Practice

Circle the groups of 10. Write the numbers.

3.

_____ groups of 10 and _____ ones is _____.

4.

_____ groups of 10 and _____ ones is _____.

5.

_____ group of 10 and _____ ones is _____.

6.

_____ groups of 10 and _____ ones is _____.

Write the number of groups of 10 and the number of ones. Then write the total.

7.

_____ groups of 10 and _____ ones is _____.

8.

_____ groups of 10 and _____ ones is _____.

LIVEWORKSHEETS

Problem Solving

Draw a picture and write the numbers to solve each problem below.

9. **Model** A monkey has 32 bananas. 10 bananas are in each bunch.

How many bunches are there? _____

How many bananas are left over? _____

10. **Model** The dogs have 21 bones. 10 bones are in each bowl.

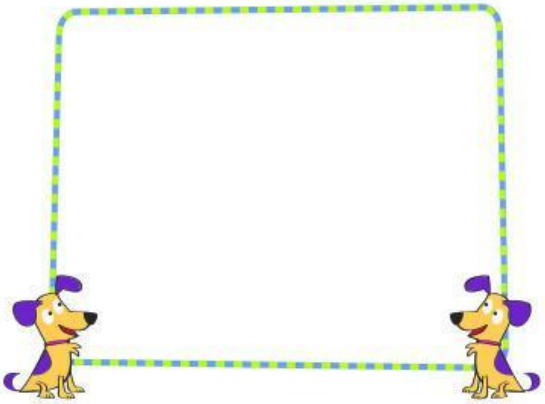

How many bowls are there? _____

How many bones are left over? _____

11. **Higher Order Thinking**

Amil writes a number.
His number has 5 groups of 10.
His number has less than 9 ones.

What number could Amil have written?

_____

12. **Assessment Practice** A store has 5 bunches of grapes and 3 left over. Each bunch has 10 grapes. How many grapes are there in all? Explain.

_____

_____

© by Savvas Learning Company LLC.

LIVEWORKSHEETS