1.uzdevums. Nosaki leņķa lielumu, ja taisnes ir paralēlas!

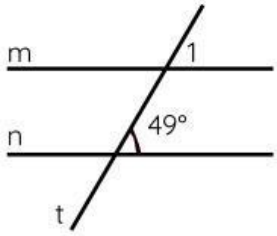	∢1 = ... - .... , ...∥ ....., krusto	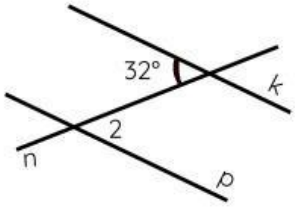	∢2 = ... - .... , ...∥ ....., krusto .....
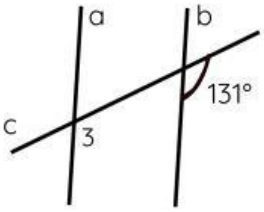	∢3 = ... - .... , ...∥ ....., krusto	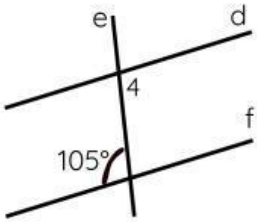	∢4 = ... - .... , ...∥ ....., krusto .....

2.uzdevums. Nosaki leņķa lielumu, ja taisnes ir paralēlas!

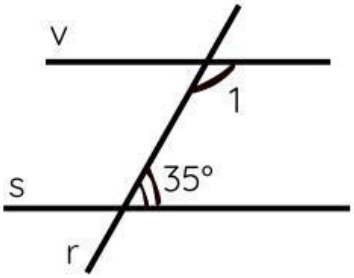

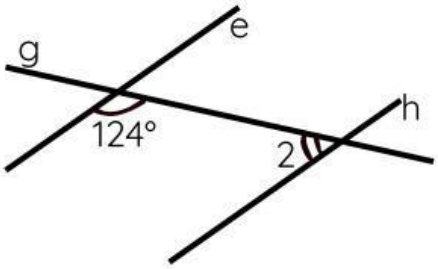

∢1 = 180° - ..... = ... -

..... ,

.....∥ ....., krusto ..... .

∢2 = 180° - ..... = ... -

..... ,

.....∥ ....., krusto ..... .

3.uzdevums. Aprēķini visus leņķus, ja taisnes ir paralēlas!

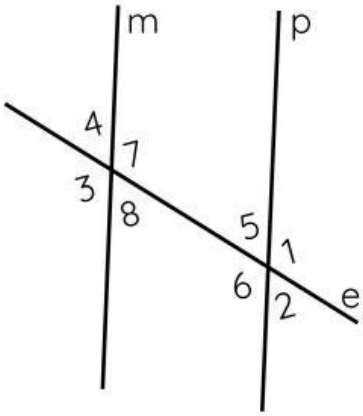

∢1 = 97°

LIVEWORKSHEETS