COUNTING 16-20

Count the number of each item and write the number in the box.

1. 

2. 

3. 

4. 

5. 

LIVEWORKSHEETS