# דף אינטראקטיבי בנושא מעגל ועיגול

**גררו את שמות החלקים של המעגל למקום המתאים**

ד.

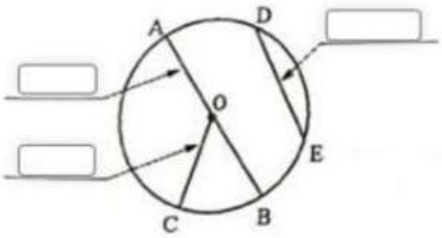


ג.

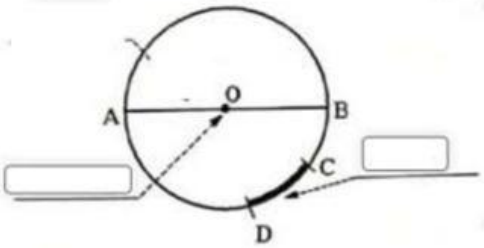


קשת | מיתר | רדיוס | קוטר | מרכז המעגל

מצאו את x בתרגילים הבאים. הנקודה המודגשת היא מרכז המעגל.

א.

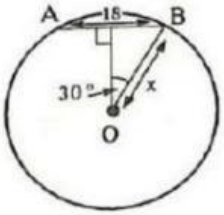


ב.

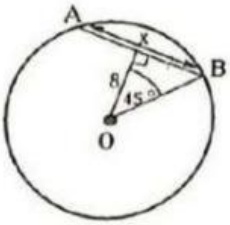


ג.

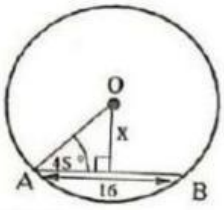


LIVEWORKSHEETS

מצאו את α ו-β . בחרו תשיבה נכונה בכל שאלה.

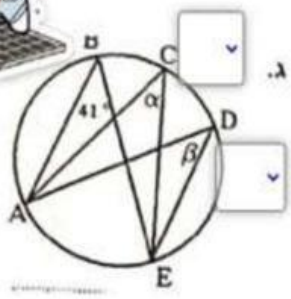


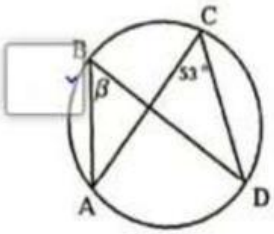


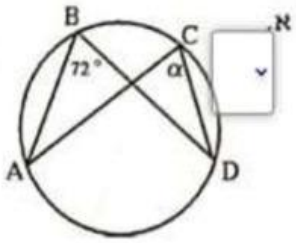


מצאו את α, אם ידוע כי AC הוא קוטר המעגל

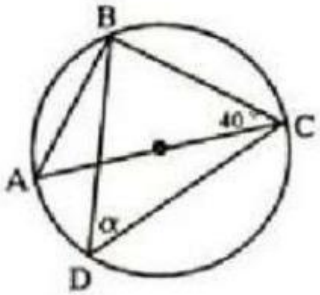


α = 40°

α = 50°

α = 25°

α = 20°

LIVEWORKSHEETS

מצאו את α בתרגילים הבאים. מתחו קו לתשובה המתאימה.

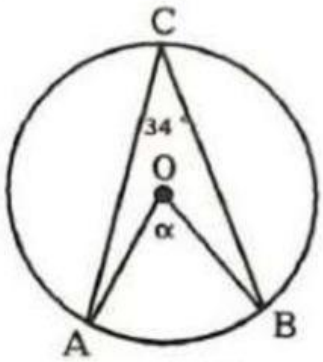


α = 25°

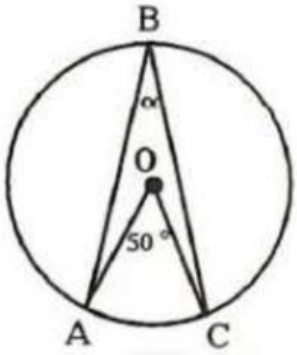


α = 68°

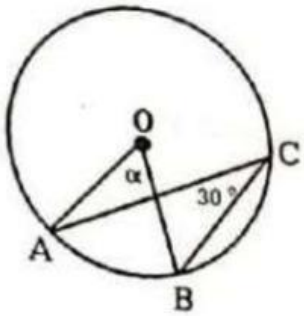


α = 60°

LIVEWORKSHEETS