STARLIGHT CHRISTIAN LEARNING CENTER

4th Quarter Summative Test SY. 2025-2026
Mathematics 1

Name: _____ Score: _____

Permit No:_____ Date: _____

PART I. A -Read carefully the question and Circle the letter of the correct answer carefully.

1. Subtraction means _____.
A. taking away B. putting together C. making bigger

Look at the subtraction sentence: 9 – 4 = 5
2. Which number is the minuend?
A. 9 B. 4 C. 5

3. Which number is the subtrahend?
A. 9 B. 4 C. 5

4. Which number is the difference?
A. 9 B. 4 C. 5

5. Which shows counting backward?
A. 1, 2, 3 B. 5, 4, 3 C. 2, 4, 6

6. What happens when we subtract zero?
🍎🍎🍎🍎🍎 – 0 = ?
A. 🍎🍎🍎🍎🍎 B. 0 C. 🍎

7. If 5 + 3 = 8, what is 8 – 3?
A. 5 B. 4 C. 6

8. If 6 + 2 = 8, what is 8 – 2?
A. 4 B. 5 C. 6

9. Mia has 13 candies. She gives 5 to her friend. How many are left?
🍬🍬🍬🍬🍬🍬🍬🍬🍬🍬🍬🍬🍬 – 🍬🍬🍬🍬🍬 = ?
A. 8 B. 9 C. 7

10. Find the difference using the tens and ones of boxes.
A. 73
B. 67
C. 76

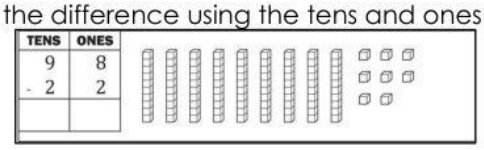

11. Find the difference using the tens and ones of boxes
A. 13
B. 12
C. 11

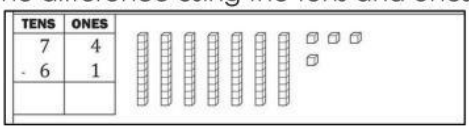

12. 41 – 20 =?
A. 21 B. 31 C. 11

13. 34 – 18 = ?
🍎🍎🍎🍎🍎🍎🍎🍎🍎🍎🍎🍎🍎🍎🍎🍎🍎🍎🍎🍎🍎🍎🍎🍎🍎🍎🍎🍎🍎🍎🍎🍎 –
🍎🍎🍎🍎🍎🍎🍎🍎🍎🍎🍎🍎🍎🍎🍎🍎 = ?
A. 16 B. 15 C. 14

LIVEWORKSHEETS

14. What do we do when we need to borrow in subtraction?
A. Add the top and bottom numbers together.
B. Regroup by taking 1 from the next column to the left.
C. Skip the column and move to the next one.

15. What is the 1st step in order find if we need to regroup or not?
A. Look at the left side of the equation . B. Start subtracting
C. "Check the right column to see which number is higher, the top or the bottom."

C - Write YES if the sentence is correct. Write NO if it is wrong.

_____ 16. Subtraction means taking away.

_____ 17. If you less 3 from 8, the answer is = 5

_____ 18. 7 less 2 is equal to 7

_____ 19. Addition and subtraction are opposite operations.

_____ 20. If 6 + 4 = 10, then 10 – 4 = 6

_____ 21. 15 – 5 = 10

_____ 22. 20 – 5 = 10

_____ 23. Sometimes we regroup in subtraction.

_____ 24. We usually subtract from the bigger number.

D - Match Column A with the correct answer in Column B. Write your answer in the blank space.

Column A	Column B
___ 25. 33 – 33	A. 25
___ 26. 19 – 4	B. 33
___ 27. 24 – 16	C. 0
___ 28. 43 – 10	D. 20
___ 29. 45 – 20	E. 8
___ 30. 50 – 30	F. 15

Part II. A - Using counting back, find the difference and write the correct answer in the blank.

1) 9 – 4 = _____
2) 18 – 9 = _____
3) 20 – 10 = _____
4) 45 – 36 = _____
5) 56 – 48 = _____
6) 38 – 23 = _____
7) 71 – 68 = _____
8) 88 – 79 = _____
9) 90 – 70 = _____
10) 66 – 58 = _____

B. Direction: Study the subtraction sentence below. Write the correct term for each number and symbol.

9 – 3 = 6

11. The number 9 is the _____.
12. The number 6 is the _____.
13. The symbol = is the _____.
14. The number 3 is the _____.
15. The symbol – is the _____.

LIVEWORKSHEETS

C - Decide if you need regroup or without regrouping, write if R if you need to regroup, and RW if not. Then, solve.

16.____
17.____
18.____
19.____
20.____
21.____
22.____
23.____
24.____
25.____

16, 80 − 66	17, 74 − 59	18, 41 − 39	19, 29 − 8	20, 83 − 23
21. 92 − 80	22, 35 − 3	23, 45 − 19	24, 98 − 69	25, 79 − 59

E – Instruction: Look at the numbers in the triangle. Use these three numbers to complete the addition (+) and subtraction (−) number sentences in the boxes.

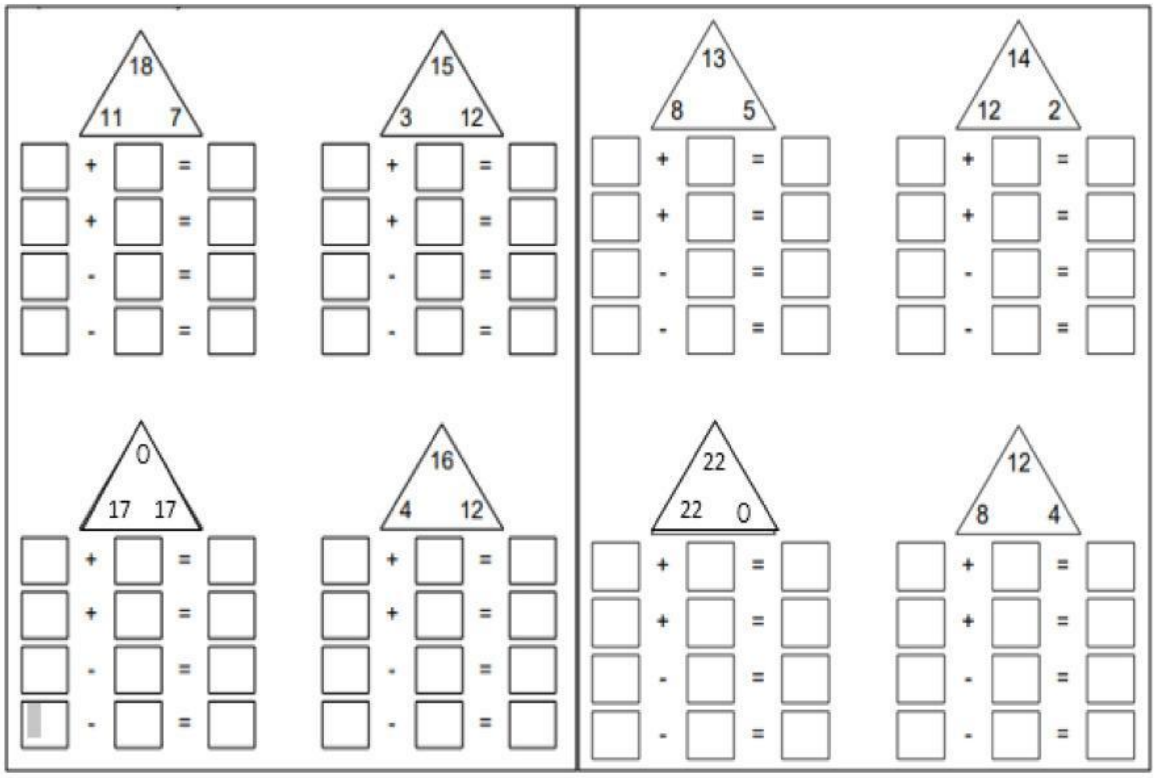

Prepared by:
Sir. Christian

God Bless you ☺

LIVEWORKSHEETS