ใบกิจกรรม จับคู่รู้ใจ...ฟังก์ชันไหนของกราฟนี้

<u>คำชี้แจง</u> ให้นักเรียนลากคำตอบลงมาเติมในกรอบใต้กราฟของฟังก์ชันให้ถูกต้อง

$y = 2x + 2$ | $y = \frac{1}{2}x + 4$ | $y = -2x + 2$

$y = -3$ | $y = 2x + 6$

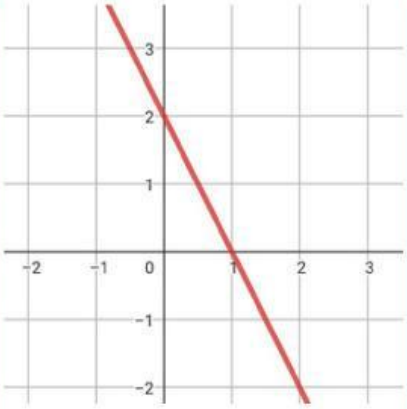

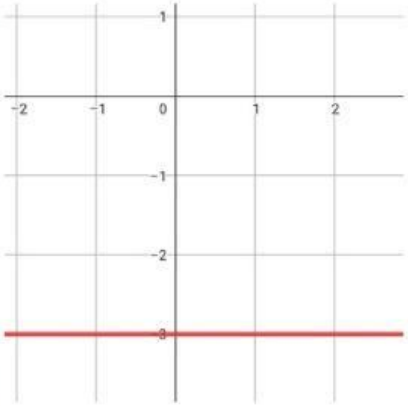

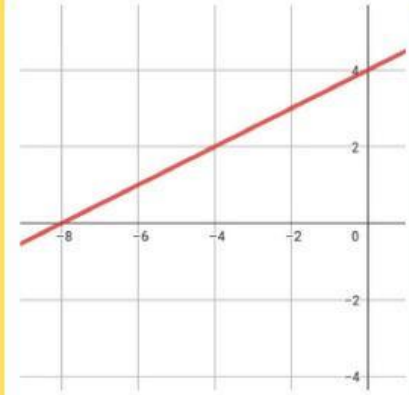

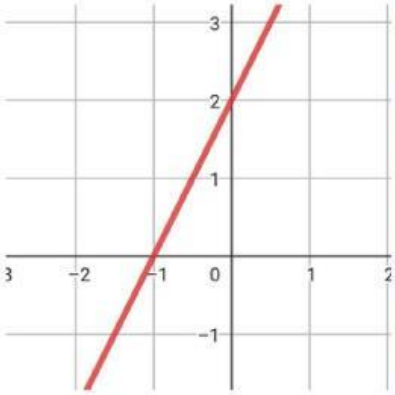

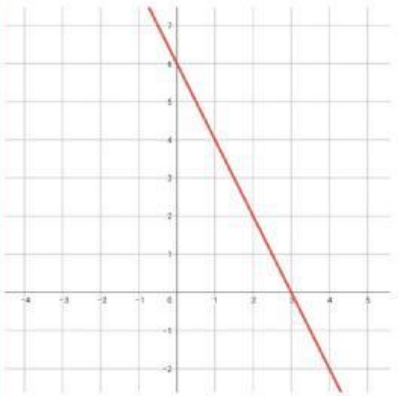

LIVEWORKSHEETS