3. أوجد $m\angle v$ إذا كان $p \| q$ و $m\angle u = 75.8°$
و $m\angle w = 104.2°$

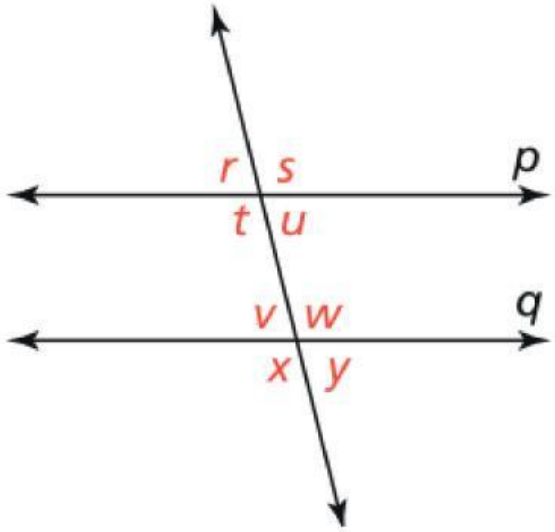

$m\angle v =$

---

4. في الشكل المجاور $m \| n$. ما قيمة x؟

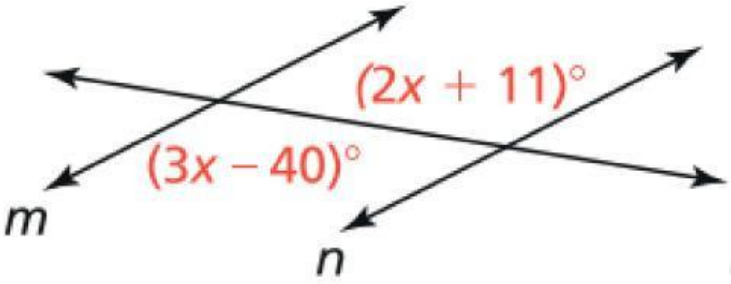

$x =$

---

7. في الشكل أدناه $d \| m$. ما قيمة x؟

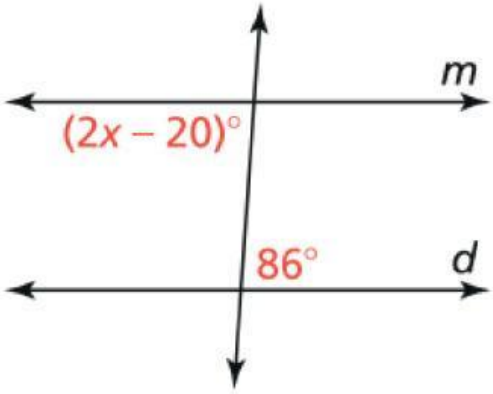

$x =$

LIVEWORKSHEETS