Name: _____ Date: _____

Write the length of the objects.

a 

cm

b 

cm

c 

cm

d 

cm

e 

cm

LIVEWORKSHEETS
LIVEWORKSHEETS