E -L K P D
I n t e r a k t i f

Oleh :

NURHAYANI, S.Pd
SMP Negeri 1 Rupat Utara

LIVEWORKSHEETS

LEMBAR KERJA PESERTA DIDIK
(LKPD)

Nama Siswa :	
Kelas :	No. Absen :

Materi 1

Unsur – unsur LINGKARAN

Nyanyi dulu yuuk...

Abis nyanyi CHEEK!!

- Membaca doa sebelum belajar
- Menyiapkan alat tulis
- Siap belajar dengan penuh semangat

Mari kita mulai....

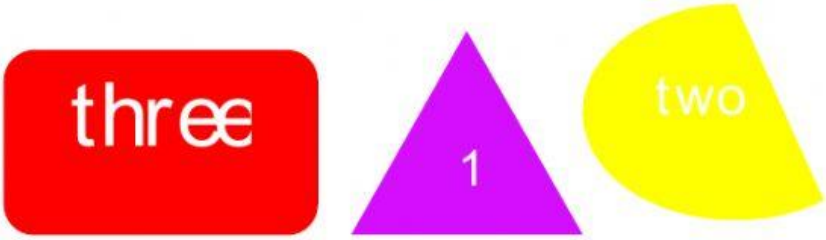

LIVEWORKSHEETS

PERHATIKAN VIDEO BERIKUT :



A. PILIHLAH SALAH SATU JAWABAN YANG PALING TEPAT DI BAWAH INI !

1. Titik yang terletak tepat di tengah lingkaran disebut ...
   A. busur
   B. titik pusat
   C. apotema
   D. juring

2. Bagian lingkaran yang merupakan kurva lengkung yang kurang dari setengah lingkaran dinamakan …
   A. busur mayor
   B. juring mayor
   C. busur minor
   D. juring minor

3. Garis yang menghubungkan dua titik pada lingkaran yang melalui titik pusat disebut…
   A. jari-jari
   B. tali busur
   C. apotema
   D. diameter

LIVEWORKSHEETS

B. Jodohkan gambar dengan cara menarik garis!

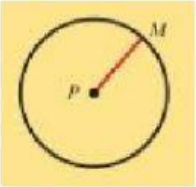

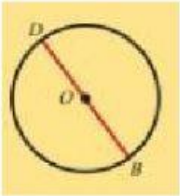

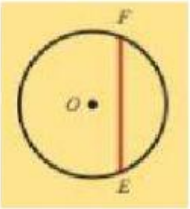

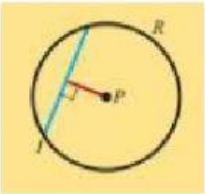

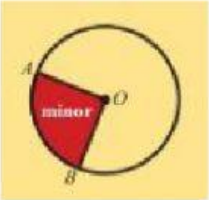

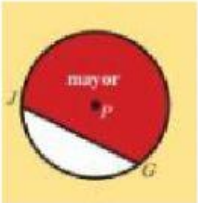

JURING

JARI-JARI

TALI BUSUR

DIAMETER

TEMBERENG

APOTEMA

LIVEWORKSHEETS

C. Fill the blank circles dengan cara menggeser circles dibawahnya !

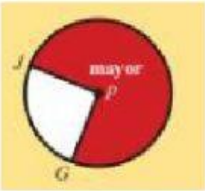

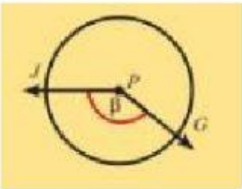

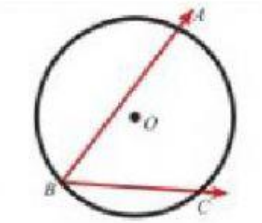

Tembereng

Sudut Pusat

Juring

Sudut Keliling

LIVEWORKSHEETS

D. Pilih jawaban yang paling tepat pada gambar berikut ini!

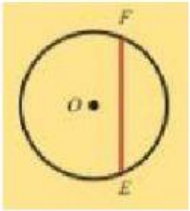

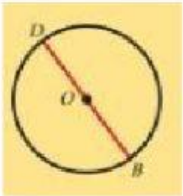

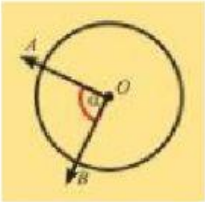

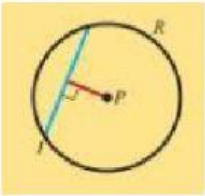



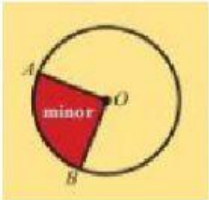

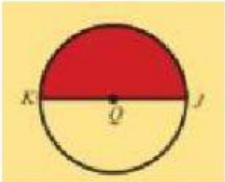

Feedback...

Pertanyaan	Ya	Tidak
Apakah kamu senang dengan pembelajaran kita hari ini?		
Apakah kamu sudah memahami materi ini dengan baik?		
Apakah kamu bisa menjawab semua pertanyaan dengan mudah?		

Terimakasih

LIVEWORKSHEETS