Jaring-Jaring

BALOK

Tandai manakah jaring-jaring di bawah ini yang dapat membentuk bangun ruang kubus. Beri tanda centang pada jawaban yang benar.





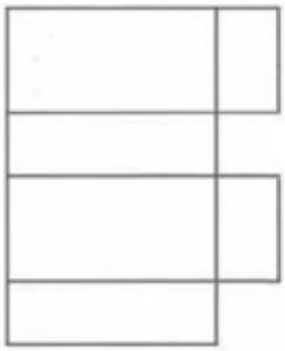

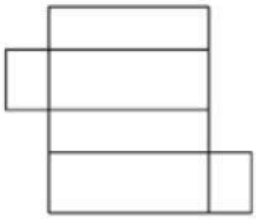

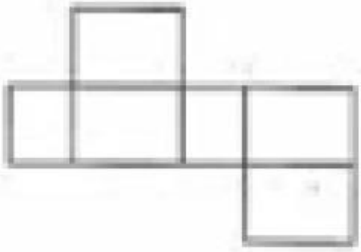



LIVEWORKSHEETS