Tugas STS Genap Matematika kelas 4

A. Pilihan ganda

Perhatikan gambar berikut untuk meniawab soal nomor 1-2 !

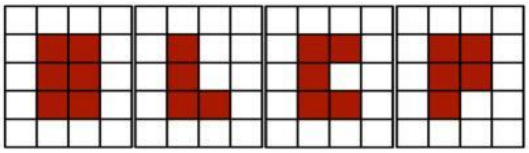

Keterangan :
Panjang sisi tiap persegi adalah 1 cm

1 2 3 4

1. Bangun yang memiliki luas 4 cm^2 ditunjukkan oleh gambar nomor … .
   A. 1
   B. 2
   C. 3
   D. 4
2. Urutan luas bangun dari yang terbesar sampai yang terkecil adalah … .
   A. 2-3-4-1
   B. 1-3-4-2
   C. 3-2-4-1
   D. 4-3-2-1

3. Perhatikan gambar dibawah ini

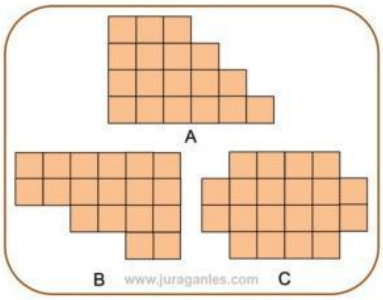

Pernyataan yang benar berdasarkan gambar bidang di atas adalah ....

A. Bidang B luasnya paling besar

B. Bidang A lebih kecil dari bidang B

C. Bidang A luasnya paling besar

D. Bidang C luasnya paling besar

4. Perhatikan gambar dibawah ini

Pernyataan yang benar berdasarkan gambar di samping adalah....

A. Volume air di wadah B paling sedikit
B. Volume air di wadah B dan D sama besar
C. Volume air di wadah C lebih sedikit dari wadah D
D. Volume air di wadah A lebih banyak dari wadah B

5. Perhatikan gambar berikut

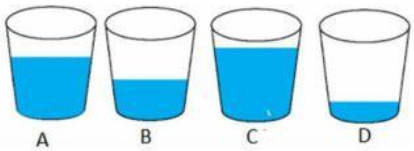

Urutan volume air dari yang terbesar adalah ....

A. C, D, A, B
B. B, C, D, A
C. C, A, B, D
D. A, B, C, D

LIVEWORKSHEETS

B. Menjodohkan

Hitunglah Luas bangun dibawah ini, pasangkan dengan jawaban yang benar

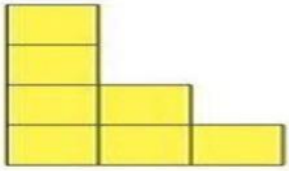

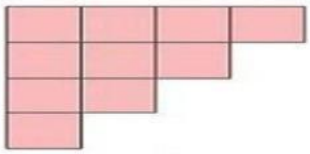





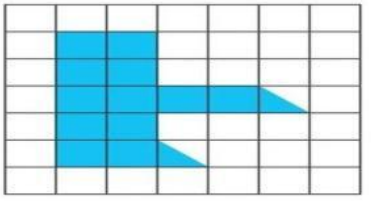

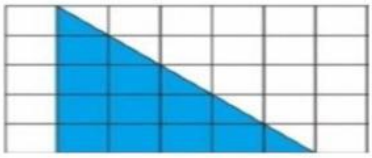







6

10

30

13

7

41

37

36

12,5

45

LIVEWORKSHEETS

C. Memindahkan

Hitunglah volume bangun dibawah ini, tarik dan taruh jawaban ke temapt yang sesuai

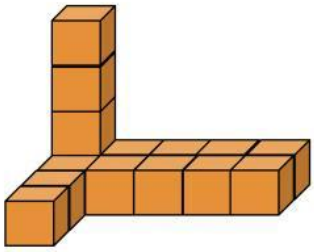

Taruh jawaban disini

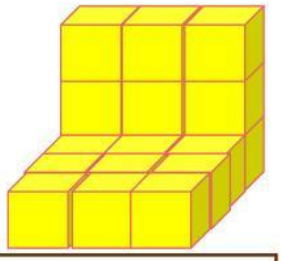

Taruh jawaban disini



Taruh jawaban disini

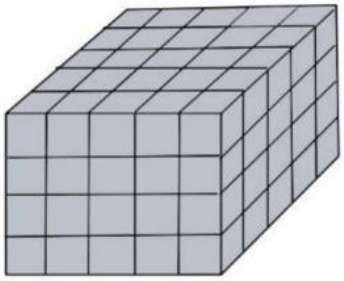

Taruh jawaban disini

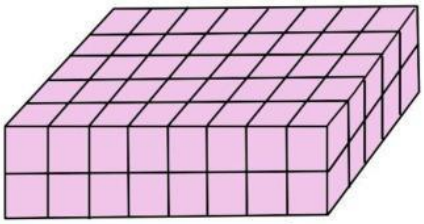

Taruh jawaban disini

Taruh jawaban disini

Taruh jawaban disini

Taruh jawaban disini

Pilih dan tarik jawaban disini

800 ml	100	500 ml
18	80	27
15	1.000 ml	

LIVEWORKSHEETS