HOW DO YOU COUNT MOVING PEOPLE?

- **VOCABULARY**

Absolute population	Población absoluta (total de personas)
Natural increase	Crecimiento natural (natalidad menos mortalidad)
Birth rate	Tasa de natalidad
Death rate	Tasa de mortalidad
Population density	Densidad de población
Immigrant	Inmigrante (persona que llega)
Emigrant	Emigrante (persona que se va)
Actual increase	Crecimiento real (incluye la migración)
Urban areas	Zonas urbanas (ciudades)
Rural areas	Zonas rurales (pueblos/campo)
Inhabitants	Habitantes

- **MATCH (Une)**

Absolute population	Birth rate - death rate
Natural increase	a **person** who **moves into** an area
Population density	Absolute population/ square km
Immigrant	total number of people living in an área
Emigrant	Natural increase + number of immigrants - number of emigrants
Actual increase	a **person** who **moves away** from an area

LIVEWORKSHEETS

- **MATCH (Une)**

INCREASE	**Urbano**
DECREASE	**Interior**
COAST	**Pocos**
INLAND	**Rural**
MOST	**Costa**
FEW	**Disminuir**
URBAN	**Aumentar**
RURAL	**Mayoría**

- **CHOOSE THE CORRECT ONE (Elige la correcta)**

The absolute population of Spain has_____ almost every year but not everywhere has experienced equal growth.

Most people choose to live near the _____or capital cities.

Most of Spain is rural; _____ people live there.

Most people live in _____areas.

- **FILL IN THE GAPS WITH THE CORRECT PAIR (Completa con el par de opuestos adecuado)**

Most / Few **Coast/ Inland** **Decreased/ Increased**

1. The population of Spain has _____ in the cities but it has _____ in some rural villages.
2. In Spain, _____ people live in urban areas, and very _____ people live in the "empty" inland.
3. Madrid is _____, but Valencia is on the _____.

- **TRUE OR FALSE? (Verdadero o Falso)**

1. ____ Natural increase is the difference between birth rate and death rate.
2. ____ Most people in Spain live in rural areas.
3. ____ In 2020, Spain had a population density of 92 inhabitants per km^2.
4. ____ Actual increase only counts births and deaths.
5. ____ Population density is the same all over Spain.

LIVEWORKSHEETS

- **FILL IN THE BLANKS (Completar los huecos)**

Urban **Natural** **Coast** **Density** **Absolute**

1. To calculate the _____ population, you count every person in an area.
2. Birth rate - Death rate = _____ increase.
3. In Spain, most people choose to live near the _____ or in big cities.
4. _____ areas (cities) have more people than rural areas.
5. _____ is calculated by dividing the absolute population by the square kilometres (km^2).

- **COMPLETE THE WORDS:**

- **a)** The total number of people living in an area: **a** _ _ _ _ _ _ _ **p** _ _ _ _ _ _ _ _ _ _
- **b)** The study of human populations: **d** _ _ _ _ _ _ _ _ _
- **c)** The number of births minus the number of deaths: **n** _ _ _ _ _ _ **i** _ _ _ _ _ _ _
- **d)** The movement of people into a country: **i** _ _ _ _ _ _ _ _ _ _
- **e)** In a city: **u** _ _ _ _

- **CHOOSE THE CORRECT ONE (Elige la correcta)**

France and Germany Barcelona and Madrid Latin America

1) During the first half of the 20th century, many Spaniards emigrated to _____ .
2) In the 1950s and 1960s, many Spaniards emigrated to_____. The same happened in 2012.
3) Since the 1960s, there has been a mass migration of people from rural to urban areas such as _____ .

- **CHOOSE THE CORRECT ONE (Elige la correcta)**

"This is the total number of people living in an area."

"This is the average number of people who live on each square kilometre of land."

"This is the difference between the number of births and number of deaths."

LIVEWORKSHEETS

a) absolute population

b) population density

c) natural increase

"An _____ is a person who moves into an área and _____

is a person who moves out of an area."

“Natural increase + number of immigrants - number of emigrants = _____”

- **TRUE OR FALSE? (Verdadero o Falso)**
- Generally, provinces on the coast have a higher population density than regions that are inland.
- One reason why people emigrate is to escape famine and war.
- People emigrate because there are too many employment opportunities in their country.
- People are constantly emigrating and immigrating.

- **CHOOSE THE CORRECT ONE (Elige la correcta)**

Choose the pyramid with a high birth rate and a low life expectancy.

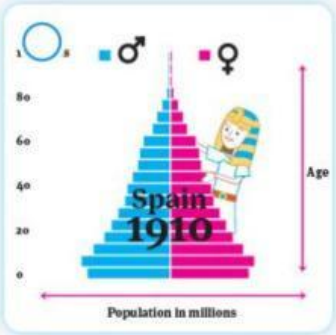

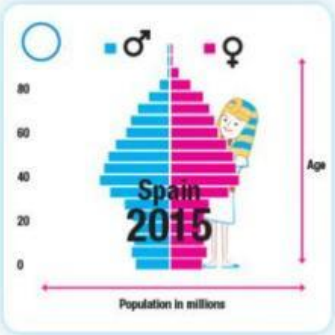

LIVEWORKSHEETS

Choose the pyramid with the lowest birth rate.

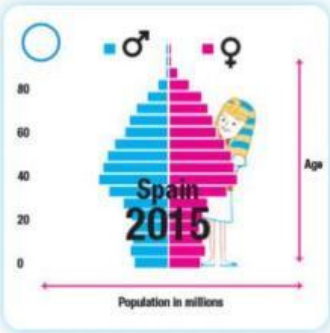

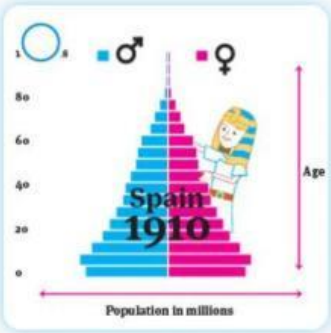

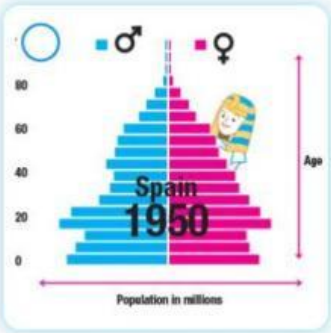

Which pyramid has a higher proportion of the population aged between 30 and 50?

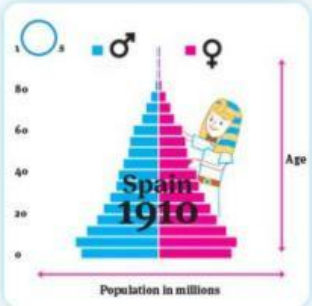

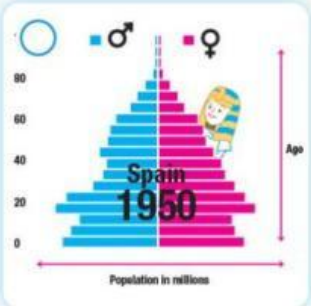

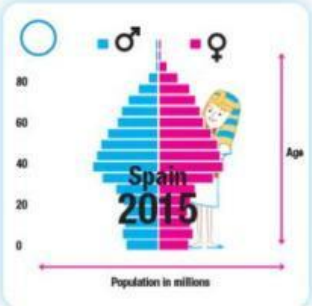

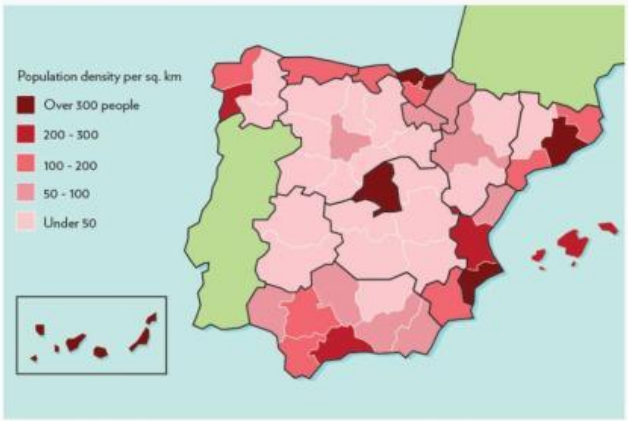

Which autonomous community has the highest population density?

- Madrid
- Extremadura
- Castilla y León
- Castilla-La Mancha

Which autonomous community has the lowest population density?

Galicia | Andalucía | Extremadura | Comunindad Valenciana

LIVEWORKSHEETS