LKPD

Matematika

Tema:

Pecahan

Nama:

Kelas:

LIVEWORKSHEETS

Potongan Pizza

Tulislah pecahan yang sesuai dengan sisa potongan pizza. di bawah ini.

$$\frac{1}{1}$$









LIVEWORKSHEETS

Mewarnai

Warnai gambar sesuai dengan pecahan di bawah ini.

$\frac{3}{10}$ Semangka



$\frac{4}{8}$ Pizza



$\frac{2}{5}$ Kue



$\frac{8}{12}$ Donat



LIVEWORKSHEETS

Pecahan Buah Semangka

Perhatikan gambar, kemudian isilah tabel di bawah ini.



Gambar	Pecahan	Cara Membaca

LIVEWORKSHEETS

Nama:

Kelas:

Bilangan Pecahan

Hubungkan bilangan pecahan yang sesuai dengan potongan pizza yang tersisa!

- $\frac{1}{1}$

- $\frac{1}{2}$



- $\frac{7}{8}$

- $\frac{3}{4}$

LIVEWORKSHEETS