BAB 2: KEDUDUKAN

Menentukan latitud dan longitud di atas glob

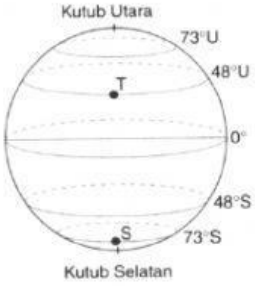

Rajah 1

1. Tentukan nilai latitud bagi titik di Rajah 1
   a) T :.....
   b) S :.....

2. Berikan koordinat bagi setiap titik yang berikut

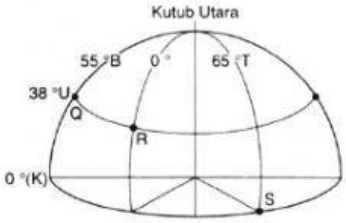

Rajah 2

a) S : .....
b) R : .....
c) Q : .....

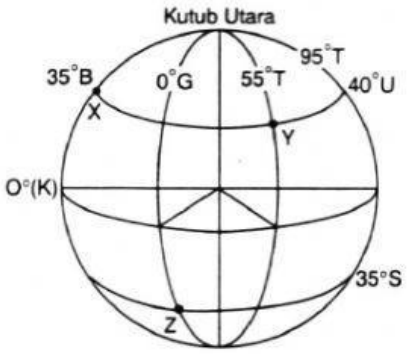

Rajah 3

3. Berikan koordinat bagi setiap titik yang berikut
   a) X : .....
   b) Z : .....
   c) Y : .....

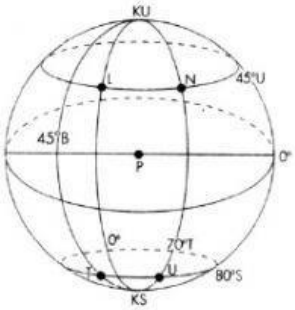

Rajah 4

4. Berikan nilai bagi titik di atas
   a) L : .....
   b) N : .....
   c) T : .....
   d) U : .....

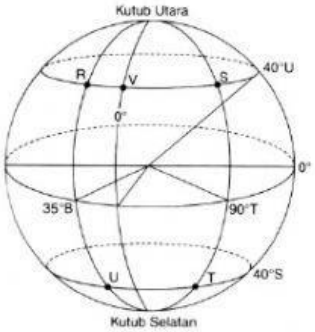

Rajah 5

5. Berikan koordinat bagi setiap titik yang diberikan di atas
   a) R : .....
   b) U : .....
   c) V : .....
   d) T : .....
   e) S : .....

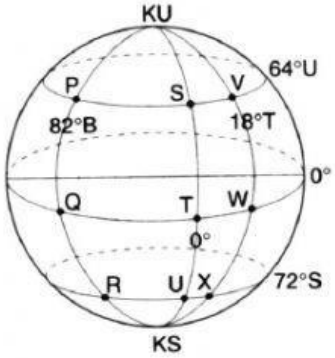

Rajah 7

6. Tentukan koordinat titik berikut
   a) P ..... f) W .....
   b) T ..... g) U .....
   c) X ..... h) S .....
   d) V ..... i) R .....
   e) Q ..... j) X .....

LIVEWORKSHEETS