LKPD

Matematika

Tema:

Penjumlahan dan Pengurangan

Nama:

Kelas:

LIVEWORKSHEETS

Penjumlahan & Pengurangan

Hitunglah buah di bawah ini.



☐ + ☐ = ☐



☐ − ☐ = ☐



☐ + ☐ = ☐



☐ − ☐ = ☐

LIVEWORKSHEETS

Hitung setiap hewan dalam kotak,
kemudian beri tanda centang (✓) jumlah yang benar!



- ◯ 2
- ◯ 5
- ◯ 7



- ◯ 4
- ◯ 3
- ◯ 5

- ◯ 5
- ◯ 2
- ◯ 3



- ◯ 7
- ◯ 9
- ◯ 5

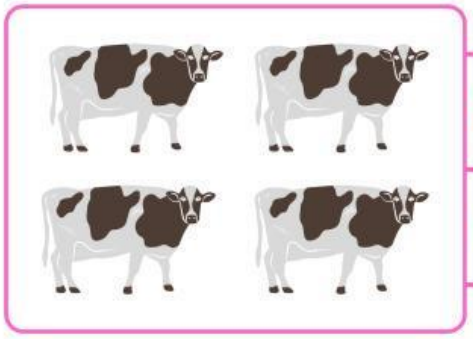

- ◯ 5
- ◯ 4
- ◯ 2



- ◯ 3
- ◯ 2
- ◯ 1



- ◯ 2
- ◯ 2
- ◯ 2



- ◯ 5
- ◯ 6
- ◯ 7

LIVEWORKSHEETS

WORDSEARCH

Cari kata yang berkaitan dengan angka dan angka bilangan!

n	o	t	b	e	l	a	s	b	a	l	d
o	h	a	s	h	l	t	b	a	n	g	u
l	c	m	c	i	s	a	t	u	a	n	a
r	t	b	i	s	l	c	d	h	r	e	w
i	h	a	c	i	h	y	m	l	s	n	r
a	r	h	g	l	i	h	i	t	u	n	g
h	s	e	l	i	s	l	g	t	n	i	s
a	g	y	m	s	a	s	n	i	c	s	t
l	w	s	a	t	u	v	a	c	h	a	s
m	b	a	l	h	l	o	r	s	n	n	i
u	a	n	g	k	a	l	u	e	y	b	l
j	t	b	c	r	i	c	k	e	t	v	g

tambah	selisih	belas
kurang	angka	satuan
hasil	nol	satu
jumlah	hitung	dua

LIVEWORKSHEETS

Taman Bunga

Perhatikan gambar, kemudian jawablah pertanyaan di bawah ini.

Pertanyaan:

Berapa banyak bunga pada gambar di atas?

☐ + ☐ = ☐

Berapa banyak kupu-kupu yang tersisa apabila kupu- kupu lain terbang?

☐ − ☐ = ☐

11	6	5	3	3	6

LIVEWORKSHEETS

Ayo Cari Jumlah Sayurnya!

Hitung jumlah sayur atau benda pada setiap gambar, lalu tarik garis untuk hubungkan dengan angka yang benar!







4

5

2

3

1

LIVEWORKSHEETS