# LKPD

## Matematika

**Tema:**

**Penjumlahan dan Pengurangan**

Nama:

Kelas:

LIVEWORKSHEETS

# Penjumlahan & Pengurangan

Hitunglah buah di bawah ini.



☐ + ☐ = ☐



☐ − ☐ = ☐



☐ + ☐ = ☐



☐ − ☐ = ☐

LIVEWORKSHEETS

Hitung setiap hewan dalam kotak,
kemudian beri tanda centang (✓) jumlah yang benar!



- ◯ 2
- ◯ 5
- ◯ 7



- ◯ 4
- ◯ 3
- ◯ 5

- ◯ 5
- ◯ 2
- ◯ 3



- ◯ 7
- ◯ 9
- ◯ 5

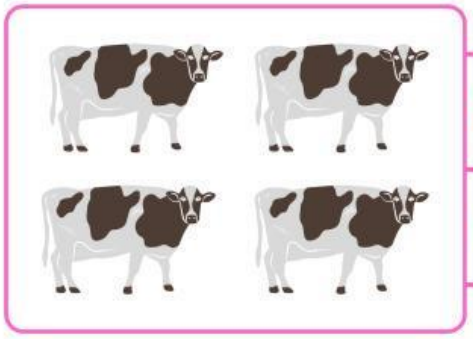

- ◯ 5
- ◯ 4
- ◯ 2



- ◯ 3
- ◯ 2
- ◯ 1



- ◯ 2
- ◯ 2
- ◯ 2



- ◯ 5
- ◯ 6
- ◯ 7

LIVEWORKSHEETS

# WORDSEARCH

Cari kata yang berkaitan dengan angka dan angka bilangan!

| | | | | | | | | | | | |
|---|---|---|---|---|---|---|---|---|---|---|---|
| n | o | t | b | e | l | a | s | b | a | l | d |
| o | h | a | s | h | l | t | b | a | n | g | u |
| l | c | m | c | i | s | a | t | u | a | n | a |
| r | t | b | i | s | l | c | d | h | r | e | w |
| i | h | a | c | i | h | y | m | l | s | n | r |
| a | r | h | g | l | i | h | i | t | u | n | g |
| h | s | e | l | i | s | l | g | t | n | i | s |
| a | g | y | m | s | a | s | n | i | c | s | t |
| l | w | s | a | t | u | v | a | c | h | a | s |
| m | b | a | l | h | l | o | r | s | n | n | i |
| u | a | n | g | k | a | l | u | e | y | b | l |
| j | t | b | c | r | i | c | k | e | t | v | g |

| | | |
|---|---|---|
| tambah | selisih | belas |
| kurang | angka | satuan |
| hasil | nol | satu |
| jumlah | hitung | dua |

LIVEWORKSHEETS

# Taman Bunga

**Perhatikan gambar, kemudian jawablah pertanyaan di bawah ini.**

## Pertanyaan:

**Berapa banyak bunga pada gambar di atas?**

☐ + ☐ = ☐

**Berapa banyak kupu-kupu yang tersisa apabila kupu- kupu lain terbang?**

☐ − ☐ = ☐

| | | | | | |
|---|---|---|---|---|---|
| 11 | 6 | 5 | 3 | 3 | 6 |

LIVEWORKSHEETS

# Ayo Cari Jumlah Sayurnya!

Hitung jumlah sayur atau benda pada setiap gambar, lalu tarik garis untuk hubungkan dengan angka yang benar!







4

5

2

3

1

LIVEWORKSHEETS