LKPD
Matematika

Tema: Mengenal Bangun Datar Segiempat

Nama kelompok:_____

Anggota kelompok : 1._____
2._____
3._____
4._____



LIVEWORKSHEETS

Bangun Datar

Tulislah nama-nama bangun datar di bawah ini.



LIVEWORKSHEETS

Tentukan bangun datar yang sesuai dengan kertas kado disamping dan gambarlah kotak yang sesuai dengan bentuk kertas kado





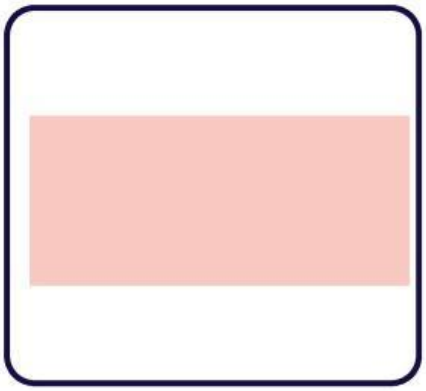

LIVEWORKSHEETS

Tentukan bangun datar yang sesuai dengan kertas kado disamping dan gambarlah kotak yang sesuai dengan bentuk kertas kado







LIVEWORKSHEETS