Hubungkan gambar sisa potongan pizza dengan pecahan yang tepat.



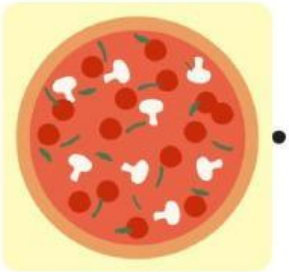

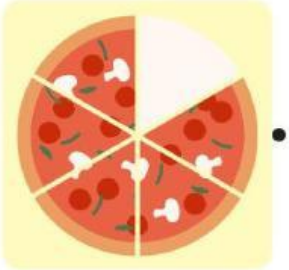

$\frac{1}{1}$

$\frac{3}{4}$

$\frac{1}{2}$

$\frac{5}{6}$

$\frac{1}{4}$

LIVEWORKSHEETS

Nama : Kelas :

PENYEBUT SAMA

PENJUMLAHAN PECAHAN

Hitunglah operasi penjumlahan pecahan di bawah ini dengan tepat!

1. $\frac{5}{2} + \frac{3}{2} = \frac{\square}{\square}$
2. $\frac{2}{4} + \frac{1}{4} = \frac{\square}{\square}$
3. $\frac{8}{7} + \frac{7}{7} = \frac{\square}{\square}$
4. $\frac{9}{11} + \frac{5}{11} = \frac{\square}{\square}$
5. $\frac{12}{26} + \frac{13}{26} = \frac{\square}{\square}$
6. $\frac{15}{40} + \frac{18}{40} = \frac{\square}{\square}$
7. $\frac{4}{3} + \frac{1}{3} = \frac{\square}{\square}$
8. $\frac{9}{5} + \frac{3}{5} = \frac{\square}{\square}$
9. $\frac{3}{9} + \frac{2}{9} = \frac{\square}{\square}$
10. $\frac{14}{16} + \frac{7}{16} = \frac{\square}{\square}$
11. $\frac{22}{37} + \frac{13}{37} = \frac{\square}{\square}$
12. $\frac{12}{55} + \frac{40}{55} = \frac{\square}{\square}$

LIVEWORKSHEETS

Nama : Tanggal

Pecahan

Penjumlahan Pecahan Biasa Berpenyebut Beda

1. $\frac{2}{3} + \frac{2}{6} = \frac{\square + \square}{\square} = \frac{\square}{\square}$

2. $\frac{1}{2} + \frac{1}{4} = \frac{\square + \square}{\square} = \frac{\square}{\square}$

3. $\frac{2}{3} + \frac{3}{4} = \frac{\square + \square}{\square} = \frac{\square}{\square}$

4. $\frac{2}{8} + \frac{1}{4} = \frac{\square + \square}{\square} = \frac{\square}{\square}$

5. $\frac{2}{3} + \frac{4}{5} = \frac{\square + \square}{\square} = \frac{\square}{\square}$

LIVEWORKSHEETS