SOAL CERITA

Jawab pertanyaan berdasarkan cerita singkat berikut!

Erik sedang pergi berbelanja ke supermarket bersama ibu nya. Mereka membeli 5 buah jeruk, 4 buah apel, dan 3 buah pisang. Erik memakan 2 buah jeruk dan adik Erik memakan 1 buah pisang

1. Berapa apel yang dibeli Erik dan ibunya?

. . . . . .

2. Berapa buah jeruk yang dimakan Erik?

. . . . . .

3. Berapa buah pisang yang tersisa?

. . . . . .

LIVEWORKSHEETS

Mari Berhitung

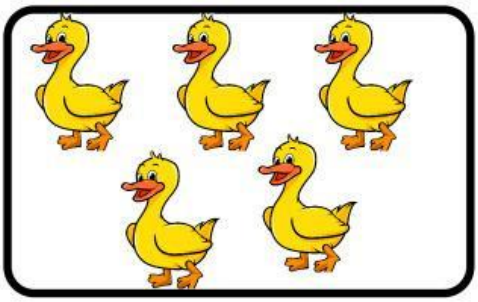

5

.....



.....



.....



.....

.....



.....

LIVEWORKSHEETS

Mari Berhitung

Berapa jumlah buah - buahan di bawah ini ?



LIVEWORKSHEETS

Menghitung Buah

Hitunglah Jumlah buah yang serupa!



5

LIVEWORKSHEETS

Menghitung Banyak Jari

Hitunglah jumlah jari dan tuliskah jawabnnya dibawah ini!

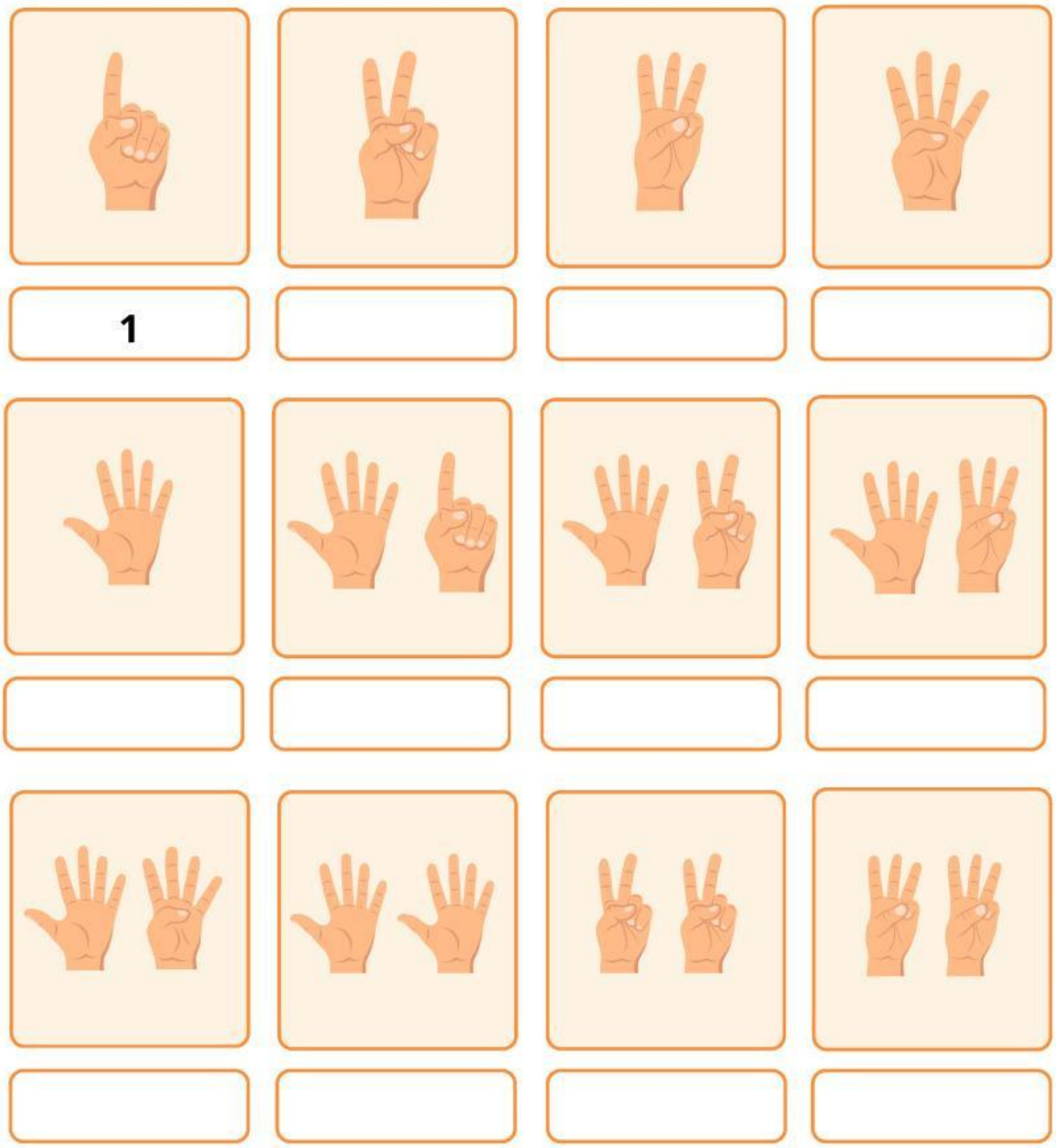

1			

LIVEWORKSHEETS

LIVEWORKSHEETS