# BERHITUNG

NAMA : KELAS :

**PETUNJUK :** Jawablah soal pilihan ganda ini dengan tepat.

A 4

B 5

C 6

A 10

B 6

C 7

LIVEWORKSHEETS

# BERHITUNG

NAMA : KELAS :

**PETUNJUK :** Ayo soal hitungan sederhana berikut!

| | |
|---|---|
| 5 – 2 = | 3 + 2 = |
| 7 – 3 = | 4+ 3 = |
| 8 – 4 = | 6 +2 = |

LIVEWORKSHEETS

# BERHITUNG

NAMA : KELAS :

**PETUNJUK :** Beri tanda ✓ pada jawaban yang benar.

## BUAH YANG BERJUMLAH 5









LIVEWORKSHEETS

# BERHITUNG

NAMA : KELAS :

**PETUNJUK :** Pasangkam tabel dengan jawaban yang benar.

## Berapa kah jumlahnya

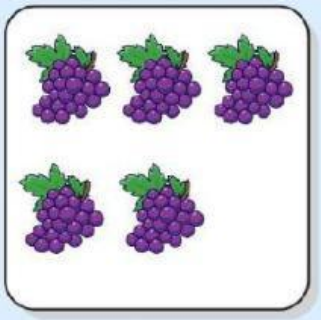





4

8

5

LIVEWORKSHEETS

# BERHITUNG

NAMA : KELAS :

**PETUNJUK :** Pasangkam tabel dengan jawaban yang benar.

| Tujuh | Empat | Sembilan |
|---|---|---|
|  | 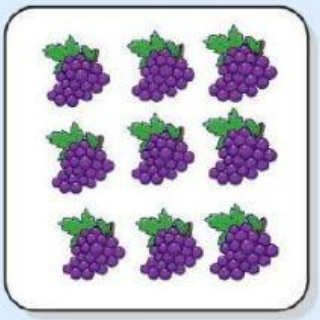 |  |
| | | |

LIVEWORKSHEETS