Nama: _____ Kelas: _____

Hitung Jumlah Buahnya!

Perhatikan gambar buah-buahan ini, lalu isilah bagian yang kosong dengan jumlah buah yang sesuai!

1. Terdapat _____ buah
2. _____ buah apel
3. _____ buah jeruk

1. Terdapat _____ buah
2. _____ buah pisang
3. _____ buah stroberi

1. Terdapat _____ buah
2. _____ buah semangka
3. _____ buah kiwi

LIVEWORKSHEETS

Nama : Kelas :

MENYEBUTKAN BANGUN RUANG

Tuliskanlah nama-nama bangun ruang di bawah ini dengan benar!

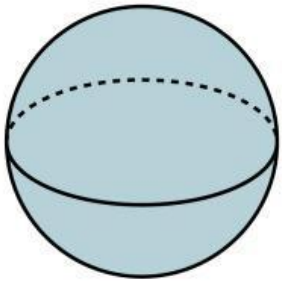

_____

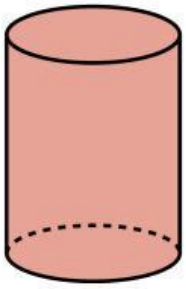

_____

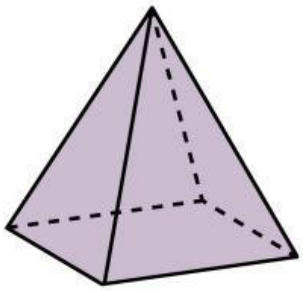

_____

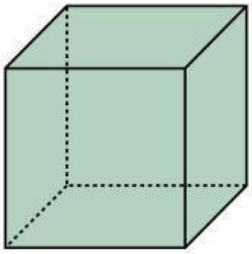

_____

LIVEWORKSHEETS

Mengenal Pecahan Setengah

Berikan tanda centang (✔) pada gambar yang menunjukan setengah bagian.

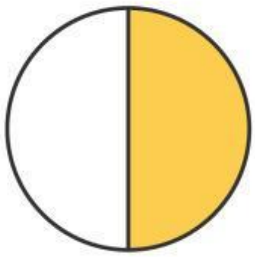

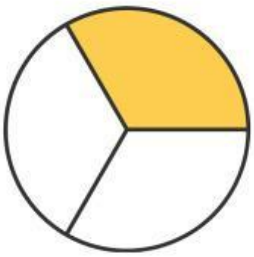

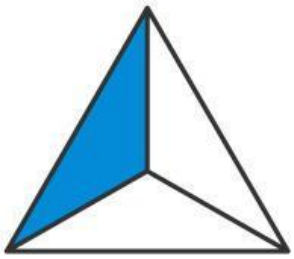

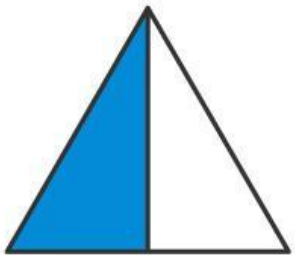





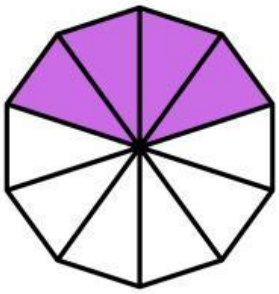

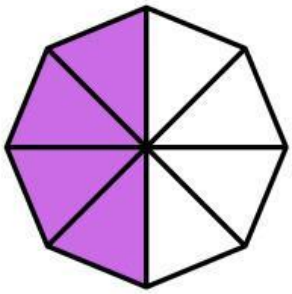

LIVEWORKSHEETS

Nama: Kelas:

TEBAK BENTUK BANGUN RUANG

Amati setiap gambar, pilih bentuk bangun ruang yang paling sesuai dengan memberi tanda ceklis pada kolom yang benar!

- [ ] Tabung
- [ ] Kubus
- [ ] Balok
- [ ] Bola

- [ ] Tabung
- [ ] Kubus
- [ ] Balok
- [ ] Bola

- [ ] Tabung
- [ ] Kubus
- [ ] Balok
- [ ] Bola

- [ ] Tabung
- [ ] Kubus
- [ ] Balok
- [ ] Limas

LIVEWORKSHEETS

Ayo Cari Jumlah Sayurnya!

Hitung jumlah sayur atau benda pada setiap gambar, lalu tarik garis untuk hubungkan dengan angka yang benar!







4

5

2

3

1

NAMA : _____ KELAS: _____

LIVEWORKSHEETS