Nama:

Kelas:

PENGURANGAN

Berapakah jumlah keseluruhan dari benda di bawah ini!





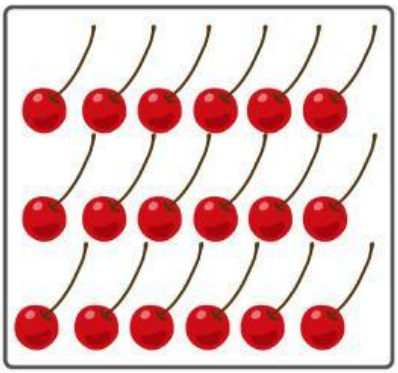

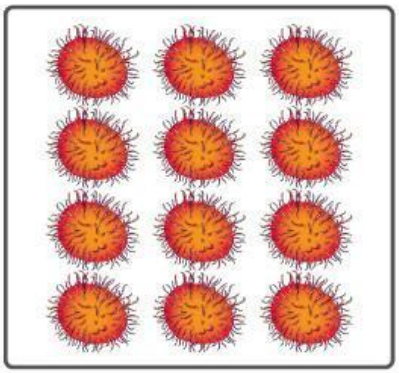





LIVEWORKSHEETS

Nama :

Kelas :

AYO BERHITUNG

Hitunglah hasil dari penjumlahan kendaraan di bawah ini!
Kerjakan seperti pada contoh soal nomor 1!

1 = 6

2 + 4 = ----------

2 = ----------

3 = ----------

4 = ----------

LIVEWORKSHEETS

Nama : _____ Nama : _____ Tanggal : / /

Hitung berapa jumlah kaki,
kemudian beri tanda centang (✓) untuk jawabannya!

Kuda

○ 2
○ 4
○ 6

Bebek

○ 4
○ 8
○ 2

Kepiting

○ 10
○ 8
○ 6

Laba-laba

○ 8
○ 5
○ 3

Harimau

○ 4
○ 8
○ 2

Ular

○ 5
○ 0
○ 7

Semut

○ 3
○ 5
○ 6

Kodok

○ 8
○ 4
○ 2

Ayam

○ 10
○ 8
○ 6

Siput

○ 0
○ 4
○ 3

Gorila

○ 4
○ 8
○ 2

Gajah

○ 7
○ 2
○ 4

LIVEWORKSHEETS

Nama : _____ Nama : _____ Tanggal : __/__/____

Hitung gambar yang sama,
Tuliskan jumlah sesuai gambarnya!



☐ ☐ ☐

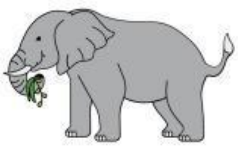 ☐ ☐ ☐

LIVEWORKSHEETS

Mari Berhitung !

Ayo isi angka yang hilang di apel-apel ini supaya pohonnya penuh kembali !

LIVEWORKSHEETS