Nama :
Kelas :

OPERASI HITUNG DASAR MATEMATIKA

I. Tentukanlah hasil dari operasi operasi matematika dibawah ini!

1. 5 + 7 + 9 = ...
2. -4 + 6 + 3 = ...
3. 15 - 7 - 3 = ...
4. -8 - 4 - 2 = ...
5. 20 - 5 - (-3) = ...
6. $\frac{3}{2}+\frac{1}{2}+\frac{1}{2}$ = ...
7. $\frac{9}{8}-\frac{3}{8}+\frac{2}{8}$ = ...
8. $\frac{5}{6}-\frac{1}{4}-\frac{1}{3}$ = ...
9. $\frac{8}{7}+\frac{5}{14}-\frac{3}{2}$ = ...
10. $1\frac{2}{3}-1\frac{1}{2}+1\frac{5}{6}$ = ...
11. 2 × 3 ÷ 1 = ...
12. 4 × 2 ÷ 2 = ...
13. (−8) × 5 ÷ (−20) = ...
14. 9 × (−6) ÷ (−18) = ...
15. (−10) × 4 ÷ (−20) = ...
16. 6 + 3 × 2 = ...
17. (12 - 4) × (8 ÷ 2) = ...
18. (12 ÷ 3) × (7 - 4) = ...
19. (20 - 10) ÷ (8 ÷ 2) + 5 = ...
20. (16 ÷ 4) × (10 - 2) = ...

II. Teka Teki Silang Matematika

(isilah kotak kotak kosong dengan bilangan yang memenuhi operasi dasar matematika)

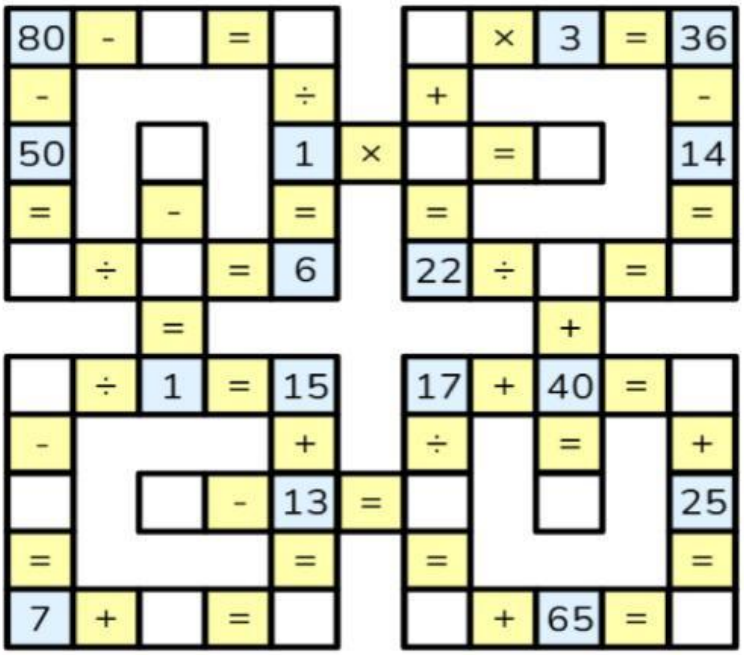

LIVEWORKSHEETS

Nama :
Kelas :

OPERASI HITUNG DASAR MATEMATIKA

I. Tentukanlah hasil dari operasi operasi matematika dibawah ini!

1. 8 + (-3) + 2 = ...
2. -7 + (-5) + 10 = ...
3. 12 + (-8) + 6 = ...
4. -6 - (-2) - 7 = ...
5. 12 - (-4) - 6 = ...
6. $\frac{3}{1}+\frac{1}{1}+\frac{1}{1}$ = ...
7. $\frac{20}{16}-\frac{3}{16}-\frac{1}{16}$ = ...
8. $\frac{2}{6}-\frac{1}{3}-\frac{1}{2}$ = ...
9. $\frac{8}{2}+\frac{3}{14}-\frac{1}{7}$ = ...
10. $4\frac{2}{3}-1\frac{4}{2}+\frac{4}{6}$ = ...
11. 6 × 3 ÷ 9 = ...
12. 8 × 2 ÷ 4 = ...
13. 5 × (−2) ÷ (−10) = ...
14. (−6) × 8 ÷ (−12) =...
15. 7 × (−3) ÷ (−7) =...
16. 12 - 8 ÷ 2 = ...
17. 15 ÷ (3 + 2) + 6 = ...
18. 18 ÷ (6 - 3) + 7 = ...
19. (18 ÷ 6) × (9 - 6) = ...
20. 40 - (5 × 6) + (18 ÷ 3) = ...

II. Teka Teki Silang Matematika

(isilah kotak kotak kosong dengan bilangan yang memenuhi operasi dasar matematika)

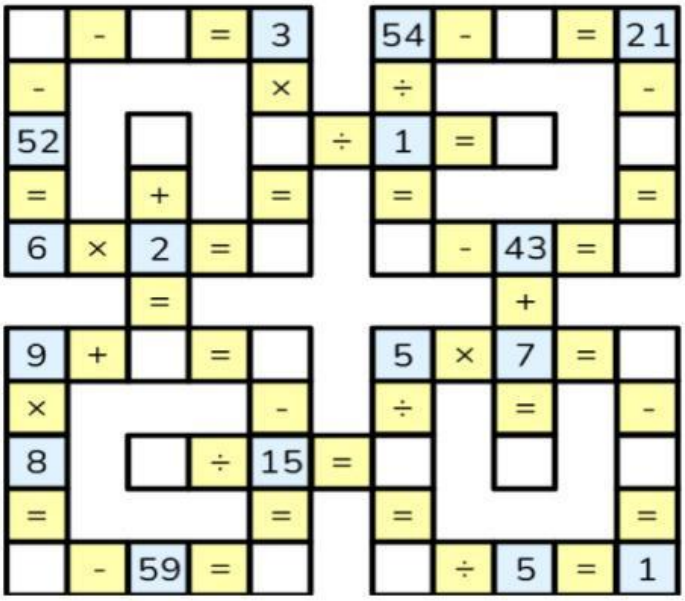

LIVEWORKSHEETS

Nama :
Kelas :

OPERASI HITUNG DASAR MATEMATIKA

I. Tentukanlah hasil dari operasi operasi matematika dibawah ini!

1. -9 + 4 + (-2) = ...
2. 15 + (-7) + (-3) = ...
3. -10 - 3 - (-5) = ...
4. 25 - 15 - 5 = ...
5. -9 - (-6) - 2 = ...
6. $\frac{3}{8}+\frac{4}{8}+\frac{1}{8}$ = ...
7. $\frac{5}{24}-\frac{3}{24}+\frac{4}{24}$ = ...
8. $\frac{7}{6}-\frac{2}{3}-\frac{1}{2}$ = ...
9. $\frac{6}{9}+\frac{4}{6}-\frac{2}{3}$ = ...
10. $2\frac{3}{5}-1\frac{1}{10}+\frac{1}{2}$ = ...
11. 9 × 3 ÷ 3 = ...
12. 12 × 2 ÷ 6 = ...
13. (−2) × 6 ÷ (−3) = ...
14. 3 × (−4) ÷ (−6) = ...
15. (−4) × 9 ÷ (−6) = ...
16. (4 + 6) × 2 = ...
17. 18 - (3 × 4) + 2 = ...
18. (20 - 10) × (8 ÷ 2) = ...
19. 30 - (4 × 6) + (12 ÷ 3) = ...
20. (20 ÷ 4) + (15 - 5) × 2 = ...

II. Teka Teki Silang Matematika

(isilah kotak kotak kosong dengan bilangan yang memenuhi operasi dasar matematika)

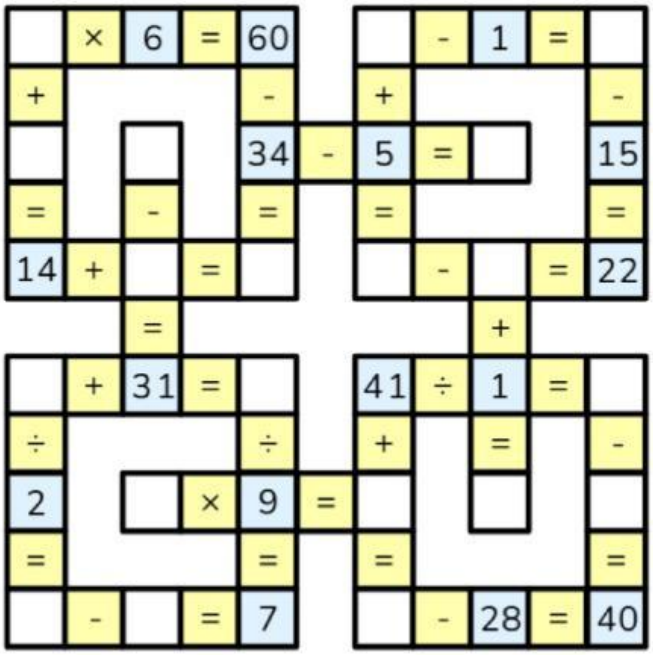

LIVEWORKSHEETS

Nama :
Kelas :

OPERASI HITUNG DASAR MATEMATIKA

I. Tentukanlah hasil dari operasi operasi matematika dibawah ini!

1. -6 + (-6) + 6 = ...
2. 20 + (-10) + 5 = ...
3. -12 + 8 + 4 = ...
4. 18 - 7 - (-4) = ...
5. -12 - (-8) - (-3) = ...
6. $\frac{4}{7}+\frac{2}{7}+\frac{1}{7}$ = ...
7. $\frac{20}{33}-\frac{10}{33}+\frac{1}{33}$ = ...
8. $\frac{2}{3}-\frac{1}{6}-\frac{1}{12}$ = ...
9. $\frac{11}{15}+\frac{7}{10}-\frac{3}{5}$ = ...
10. $1\frac{1}{3}+2\frac{1}{6}-\frac{1}{2}$ = ...
11. 15 × 4 ÷ 5 = ...
12. 10 × 6 ÷ 2 = ...
13. 10 × (−3) ÷ 15 = ...
14. (−11) × 4 ÷ 22 = ...
15. 12 × (−2) ÷ 24 = ...
16. 15 ÷ 3 + 5 = ...
17. (12 ÷ 4) × (6 - 2) = ...
18. (18 + 2) ÷ (10 - 8) = ...
19. (12 ÷ 3) + (14 - 8) × 2 = ...
20. (18 - 6) ÷ (8 ÷ 4) + 7 = ...

II. Teka Teki Silang Matematika

(isilah kotak kotak kosong dengan bilangan yang memenuhi operasi dasar matematika)

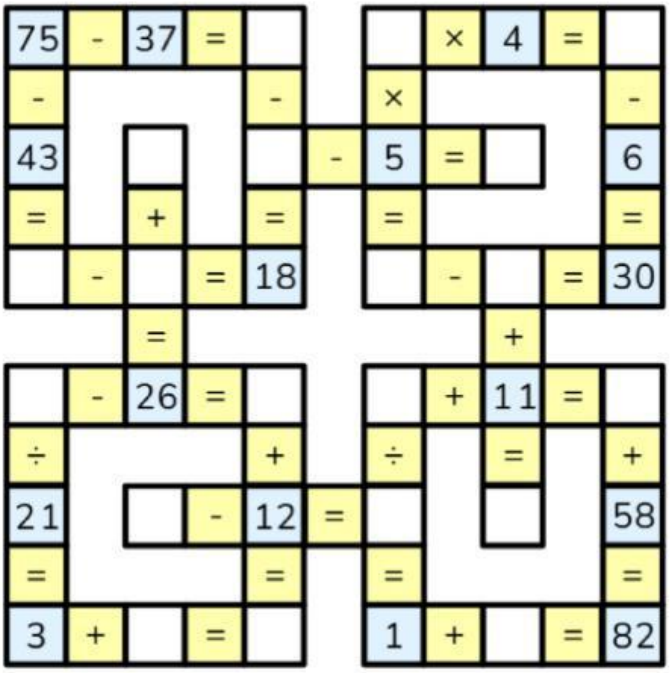

LIVEWORKSHEETS

Nama :
Kelas :

OPERASI HITUNG DASAR MATEMATIKA

I. Tentukanlah hasil dari operasi operasi matematika dibawah ini!

1. 9 + (-5) + (-7) = ...
2. -3 + 2 + 11 = ...
3. 14 - 9 - (-2) = ...
4. -15 - (-5) - 6 = ...
5. 30 - 10 - 8 = ...
6. $\frac{1}{10}+\frac{1}{5}+\frac{1}{5}$ = ...
7. $\frac{6}{1}-\frac{2}{6}+\frac{2}{3}$ = ...
8. $\frac{5}{4}-\frac{1}{4}-\frac{1}{1}$ = ...
9. $\frac{8}{42}+\frac{5}{3}-\frac{3}{7}$ = ...
10. $3\frac{3}{3}-1\frac{3}{2}+\frac{2}{6}$ = ...
11. 18 × 2 ÷ 3 = ...
12. 20 × 3 ÷ 5 = ...
13. (−9) × (−2) ÷ 18 = ...
14. (−13) × (−3) ÷ 39 = ...
15. 2 × 5 ÷ 10 = ...
16. 9 - 2 × 3 = ...
17. 20 - (6 + 2) × 2 = ...
18. 30 - (12 ÷ 3) × 4 = ...
19. (16 ÷ 4) × (10 - 6) = ...
20. 30 - (12 ÷ 3) × (6 + 2) = ...

II. Teka Teki Silang Matematika

(isilah kotak kotak kosong dengan bilangan yang memenuhi operasi dasar matematika)

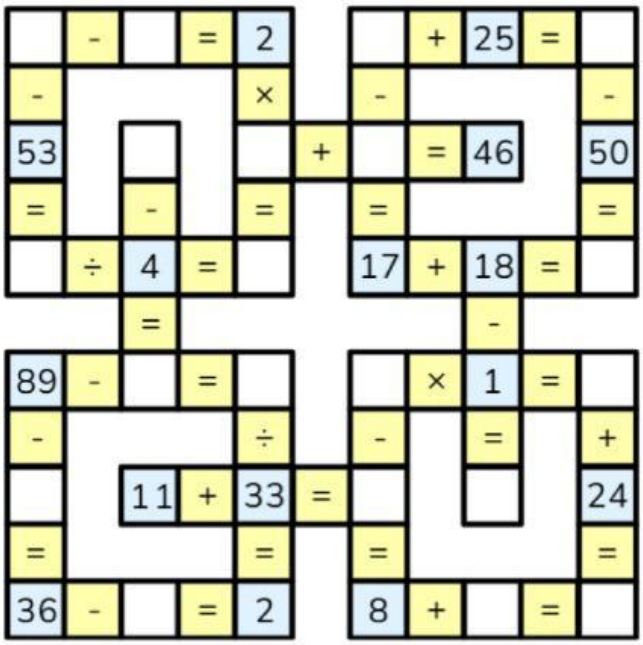

LIVEWORKSHEETS

Nama :
Kelas :

OPERASI HITUNG DASAR MATEMATIKA

I. Tentukanlah hasil dari operasi operasi matematika dibawah ini!

1. 14 + (-9) + 3 = ...
2. -15 + (-5) + 25 = ...
3. 10 + 0 + (-6) = ...
4. -20 - (-15) - (-5) = ...
5. 16 - 7 - (-9) = ...
6. $\frac{1}{2}+\frac{2}{1}+\frac{1}{2}$ = ...
7. $\frac{3}{12}-\frac{3}{12}+\frac{3}{12}$ = ...
8. $\frac{2}{3}-\frac{1}{3}-\frac{3}{2}$ = ...
9. $\frac{10}{20}+\frac{7}{14}-\frac{5}{5}$ = ...
10. $\frac{2}{3}-3\frac{1}{2}+\frac{3}{6}$ = ...
11. (−2) × 3 ÷ 1 = ...
12. 4 × (−3) ÷ 2 = ...
13. 6 × (−5) ÷ 10 = ...
14. (−7) × 2 ÷ 14 = ...
15. 8 × 3 ÷ 12 = ...
16. (10 - 6) × 2 = ...
17. (9 + 3) ÷ (6 - 4) = ...
18. (16 ÷ 4) + (9 - 3) = ...
19. 40 - (10 ÷ 2) × (4 + 2) = ...
20. (24 ÷ 6) × (9 - 5) = ...

II. Teka Teki Silang Matematika

(isilah kotak kotak kosong dengan bilangan yang memenuhi operasi dasar matematika)

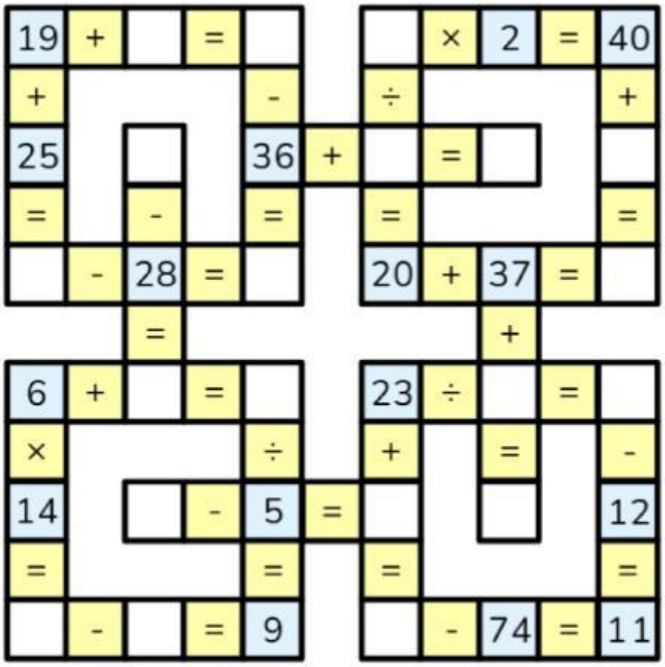

LIVEWORKSHEETS

Nama :
Kelas :

OPERASI HITUNG DASAR MATEMATIKA

I. Tentukanlah hasil dari operasi operasi matematika dibawah ini!

1. -8 + 6 + (-4) = ...
2. 18 + (-7) + (-8) = ...
3. -20 + 15 + 10 = ...
4. -18 - 4 - (-2) = ...
5. 22 - 11 - 6 = ...
6. $\frac{3}{4}+\frac{1}{4}+\frac{1}{4}$ = ...
7. $\frac{9}{12}-\frac{3}{12}+\frac{2}{12}$ = ...
8. $\frac{5}{2}-\frac{1}{3}-\frac{1}{6}$ = ...
9. $\frac{4}{18}+\frac{5}{12}-\frac{6}{6}$ = ...
10. $3\frac{2}{5}-2\frac{1}{15}+1\frac{5}{25}$ = ...
11. (−6) × 2 ÷ 3 = ...
12. 9 × (−2) ÷ 3 = ...
13. 20 × (−3) ÷ (−5) = ...
14. 3 × 4 ÷ 6 = ...
15. (−4) × 6 ÷ 8 = ...
16. 12 ÷ (2 + 2) = ...
17. (12 ÷ 3) + (7 × 2) = ...
18. (6 × 2) ÷ (8 - 6) = ...
19. (20 - 8) ÷ (12 ÷ 6) + 5 = ...
20. (18 ÷ 6) + (14 - 8) × 2 = ...

II. Teka Teki Silang Matematika

(isilah kotak kotak kosong dengan bilangan yang memenuhi operasi dasar matematika)

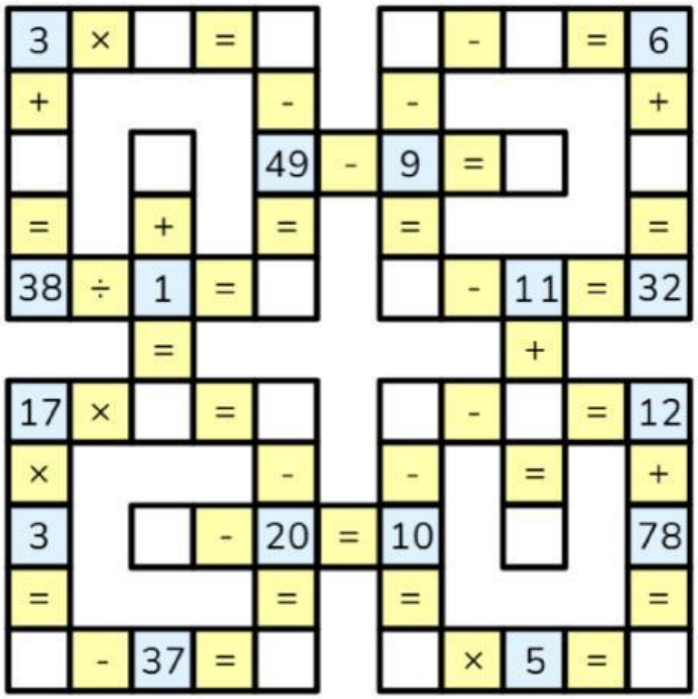

LIVEWORKSHEETS

Nama :
Kelas :

OPERASI HITUNG DASAR MATEMATIKA

I. Tentukanlah hasil dari operasi operasi matematika dibawah ini!

1. 7 + 9 + (-10) = ...
2. -11 + 5 + (-3) = ...
3. -25 - (-10) - 7 = ...
4. 12 - 6 - (-4) = ...
5. -14 - (-7) - (-3) = ...
6. $\frac{1}{2}+\frac{4}{8}+\frac{2}{8}$ = ...
7. $9-\frac{1}{16}+\frac{8}{4}$ = ...
8. $\frac{5}{7}-\frac{1}{14}-\frac{1}{21}$ = ...
9. $\frac{8}{2}+\frac{5}{6}-\frac{3}{3}$ = ...
10. $2\frac{3}{3}-1\frac{2}{2}+\frac{6}{6}$ = ...
11. (−8) × 4 ÷ 2 = ...
12. 12 × (−3) ÷ 6 = ...
13. (−15) × (−3) ÷ 5 = ...
14. 10 × (−6) ÷ (−2) = ...
15. (−18) × (−2) ÷ 3 = ...
16. (-8) + 12 ÷ 3 = ...
17. 24 - (8 ÷ 2) × 2 = ...
18. 25 - (5 × 4) + 5 = ...
19. (18 ÷ 9) + (12 - 6) × 2 = ...
20. (20 ÷ 4) × (12 + 6) = ...

II. Teka Teki Silang Matematika

(isilah kotak kotak kosong dengan bilangan yang memenuhi operasi dasar matematika)

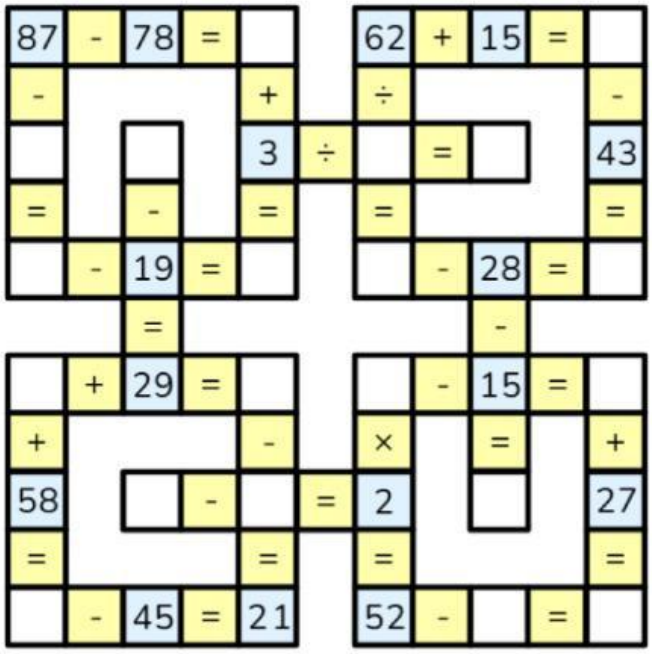

LIVEWORKSHEETS

Nama :
Kelas :

OPERASI HITUNG DASAR MATEMATIKA

I. Tentukanlah hasil dari operasi operasi matematika dibawah ini!

1. 16 + (-8) + (-4) = ...
2. -14 + 9 + 7 = ...
3. 25 + (-12) + (-5) = ...
4. 10 - 8 - (-2) = ...
5. -16 - (-5) - 6 = ...
6. $\frac{3}{5}+\frac{1}{1}+\frac{1}{1}$ = ...
7. $\frac{6}{6}-\frac{3}{6}+\frac{3}{6}$ = ...
8. $\frac{3}{2}-\frac{2}{3}-\frac{2}{2}$ = ...
9. $\frac{12}{21}+\frac{9}{3}-\frac{7}{7}$ = ...
10. $2\frac{2}{3}-4\frac{1}{2}+8\frac{1}{6}$ = ...
11. (−10) × 2 ÷ 5 = ...
12. 14 × (−2) ÷ 7 = ...
13. 9 × (−2) ÷ (−3) = ...
14. (−8) × (−4) ÷ 2 = ...
15. (−12) × (−2) ÷ 6 = ...
16. (6 + 2) ÷ 2 = ...
17. (6 × 3) - (12 ÷ 4) = ...
18. (12 ÷ 6) + (10 - 7) = ...
19. 50 - (7 × 6) + (12 ÷ 2) = ...
20. 36 - (6 × 5) + (10 ÷ 2) = ...

II. Teka Teki Silang Matematika

(isilah kotak kotak kosong dengan bilangan yang memenuhi operasi dasar matematika)

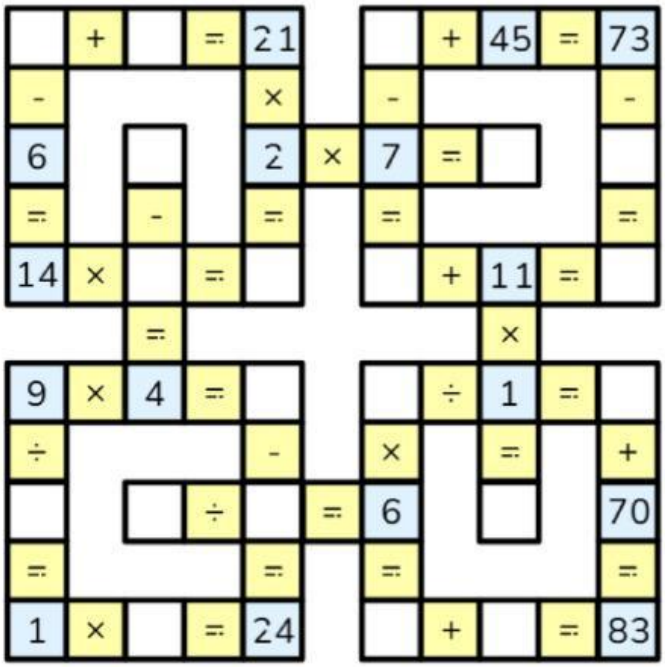

LIVEWORKSHEETS

Nama :
Kelas :

OPERASI HITUNG DASAR MATEMATIKA

I. Tentukanlah hasil dari operasi operasi matematika dibawah ini!

1. -10 + (-10) + 15 = ...
2. 30 + (-20) + (-5) = ...
3. 28 - 12 - 9 = ...
4. -22 - (-11) - (-4) = ...
5. 15 - 7 - (-5) = ...
6. $\frac{2}{4}+\frac{3}{3}+\frac{4}{2}$ = ...
7. $\frac{6}{5}-\frac{3}{15}+\frac{2}{25}$ = ...
8. $\frac{5}{3}-\frac{1}{1}-\frac{1}{2}$ = ...
9. $\frac{8}{4}+\frac{5}{16}-\frac{3}{8}$ = ...
10. $2\frac{6}{4}-1\frac{6}{2}+\frac{6}{6}$ = ...
11. (−9) × 3 ÷ 9 = ...
12. 16 × (−4) ÷ 8 = ...
13. (−2) × (−3) ÷ 6 = ...
14. (−4) × (−5) ÷ 2 = ...
15. (−6) × (−2) ÷ 3 = ...
16. 14 - (4 × 2) = ...
17. (12 + 6) ÷ (10 - 8) = ...
18. 18 - (12 ÷ 3) × 2 = ...
19. (20 ÷ 5) × (9 - 3) = ...
20. (24 - 12) ÷ (6 ÷ 3) = ...

II. Teka Teki Silang Matematika

(isilah kotak kotak kosong dengan bilangan yang memenuhi operasi dasar matematika)

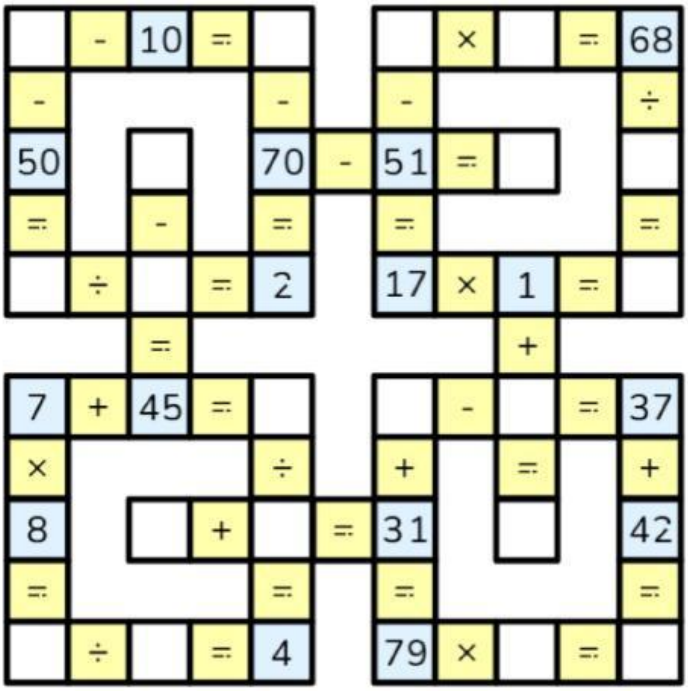

LIVEWORKSHEETS