Sucesiones de figuras

En las siguientes sucesiones **indica** la figura que sigue:

1.

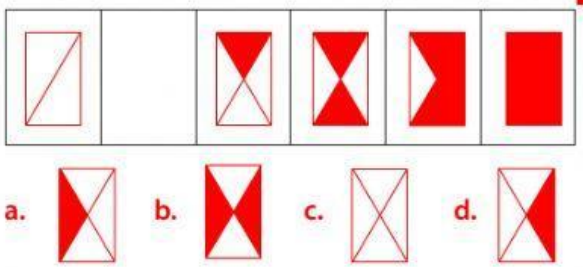

a. b. c. d.

2.

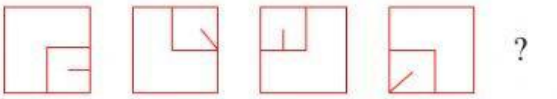

a. b. c. d.

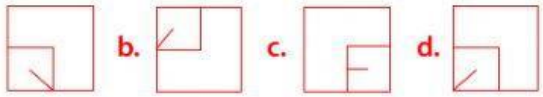

3.



a. b. c. d.

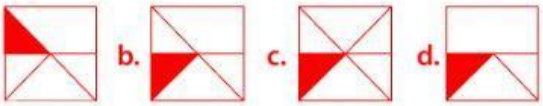

4.



a. b. c. d.

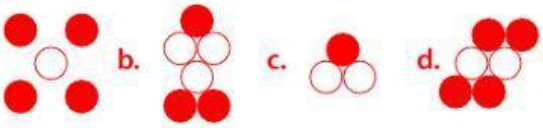

5.

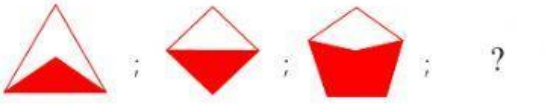

a. b. c. d.

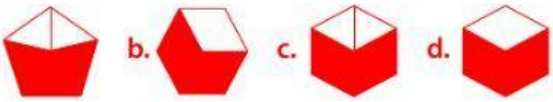

6.



a. c.

b. d.

7.

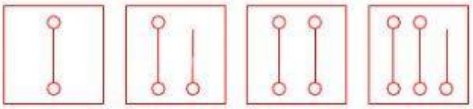

a. b. c. d.

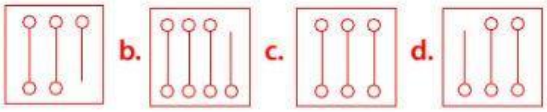

8.

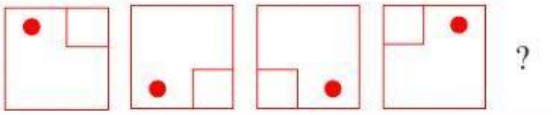

a. b. c. d.

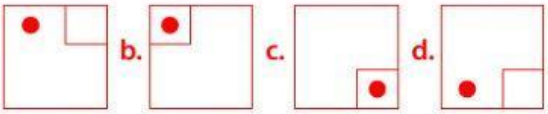

9.

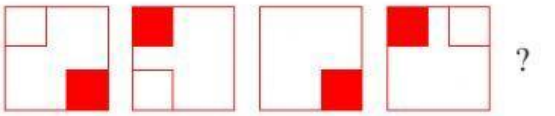

a. b. c. d.



10.

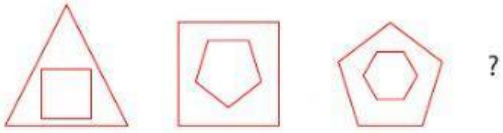

a. b. c. d.

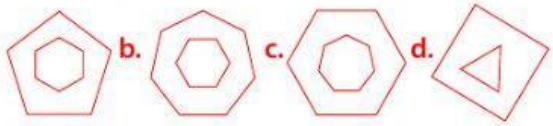

LIVEWORKSHEETS