FRACTION PRACTICE

Write the fraction the shaded parts of each shape represent.

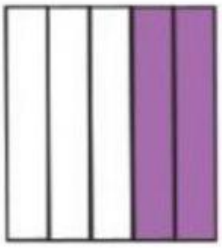

$\frac{2}{5}$

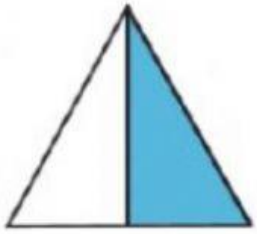





LIVEWORKSHEETS