Name:_____. Group:_____.

Skip Counting. Fill in the blanks with the missing numbers.

2	4	6	__	10	12	14	16	__	20	__
3	__	9	12	__	18	21	__	27	__	__
4	__	12	16	20	__	__	32	__	40	__
5	__	15	__	25	30	35	__	__	__	55
__	__	6	8	10	__	14	16	__	__	22
__	6	9	12	15	__	__	__	27	__	__
__	__	12	16	20	24	__	__	__	44	48

USA currency coins. Count the coins

a)	5 cents, 1 cent, 1 cent, 1 cent, 1 cent		cents
b)	5 cents, 5 cents, 5 cents, 1 cent, 1 cent, 1 cent		cents
c)	10 cents, 5 cents, 5 cents, 1 cent, 1 cent, 1 cent		cents
d)	10 cents, 5 cents, 5 cents, 5 cents, 5 cents		cents
e)	10 cents, 10 cents, 10 cents, 5 cents, 1 cent		cents
f)	5 cents, 5 cents, 5 cents, 5 cents, 5 cents		cents
g)	10 cents, 10 cents, 10 cents, 10 cents, 10 cents		cents

LIVEWORKSHEETS

Even and Odd Numbers. Select the even numbers.

22	21	108	233
3	96	111	200

Add / Subtract. Solve the following equations.

10 + 15	44 + 36	81 + 27	12 + 88
24 − 16	59 − 40	99 − 32	63 − 29

Number Grid Puzzle. Doubles. Complete the Number Pattern.

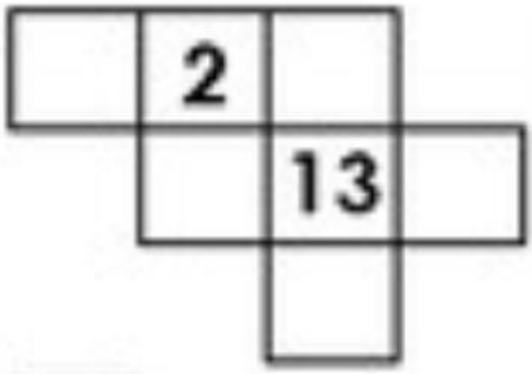

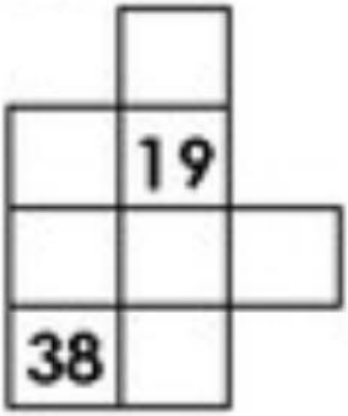

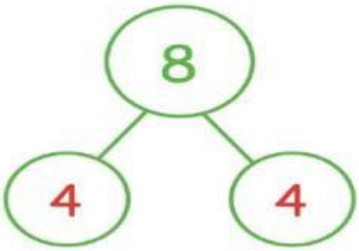

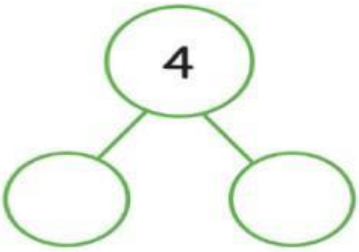

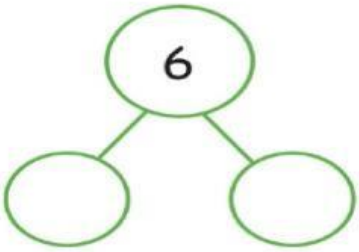

LIVEWORKSHEETS

Write more than (">"), less than ("<") or equal to (=) to compare numbers.

84 ____ 48 19 ____ 19

17 ____ 17 22 ____ 33

90 ____ 30 41 ____ 41

Number Stories

1. Max and Rosa picked cherries.
They ate 18 cherries for lunch.
Rosa ate 6 more cherries after lunch.
How many cherries did Max and Rosa eat?

cherries

2. There were 4 children on the bus.
At the next stop, 13 more got on.
Then 6 more children got on.
How many children were on the bus?



children

LIVEWORKSHEETS