2

Urutkan Pertumbuhannya!

Perhatikan gambar tanaman tomat di bawah ini!
Kemudian tulislah angka 1, 2, 3, 4, 5, 6 pada setiap kotak sesuai dengan urutan pertumbuhan pada tomat













LIVEWORKSHEETS