K8Worksheets

Area of Rhombus

Find the area of the rhombus with the given diagonals.

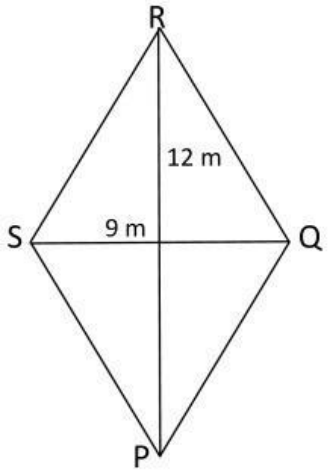

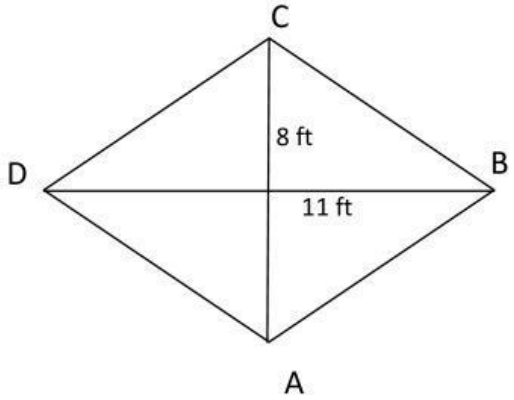

Area of PQRS = _____

Area of ABCD = _____

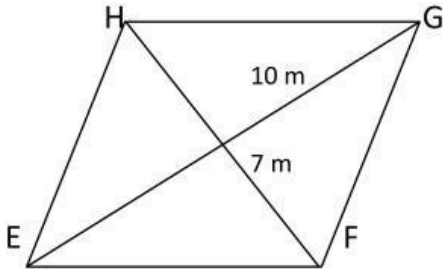

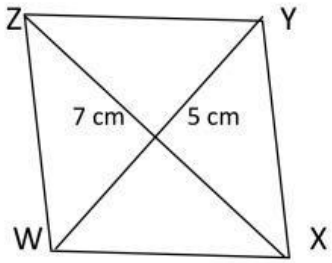

Area of EFGH = _____

Area of WXYZ = _____

© k8worksheets.com

LIVEWORKSHEETS