EMEF Dr. Osvaldo Aranha
SALA DO EVAM

1. QUAL É O NÚMERO?

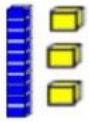 = 12 23 13

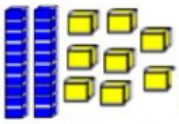 = 28 18 38

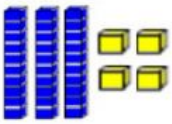 = 14 34 25

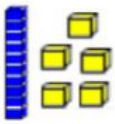 = 32 53 15

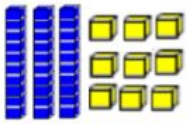 = 46 15 39

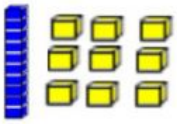 = 29 25 19

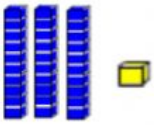 = 36 31 38

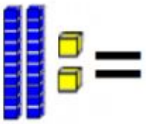 = 12 22 32

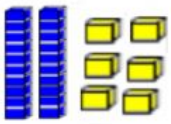 = 36 16 26

LIVEWORKSHEETS

2. LEIA COM ATENÇÃO E REPRESENTE O NÚMERO:

Uma dezena e seis unidades	
Nove unidades	
Duas dezenas e três unidades	
Três dezenas e sete unidades	
Uma dezena e cinco unidades	
Duas dezenas e quatro unidades	

RELACIONE OS NUMERAIS:

3 DEZENAS + 9 UNIDADES	**20 + 2**
2 DEZENAS + SETE UNIDADES	**5**
1 DEZENA + 8 UNIDADES	**30 + 9**
5 UNIDADES	**10 + 1**
1 DEZENA + 1 UNIDADE	**20 + 7**
3 DEZENAS E 2 UNIDADES	**10 + 8**

LIVEWORKSHEETS