ใบงานรู้จักบล็อกคำสั่ง

ชื่อ.....เลขที่..... ชั้น .....

คำสั่ง ให้นักเรียนดูบล็อกภาพคำสั่ง Scratch ในใบงานและเลือกคำตอบที่ถูกต้อง จำนวน 10 ข้อ

1. 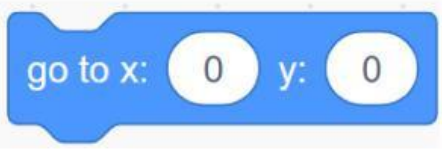

2. 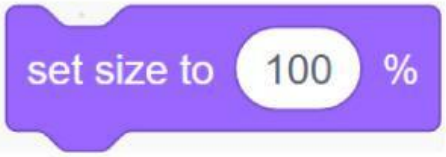

3. 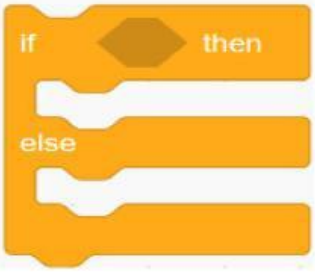

4. 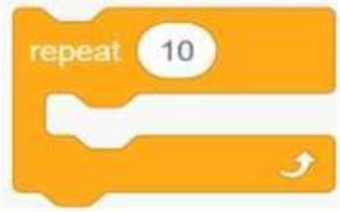

5. 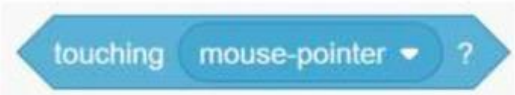

LIVEWORKSHEETS

6.

7.

8. 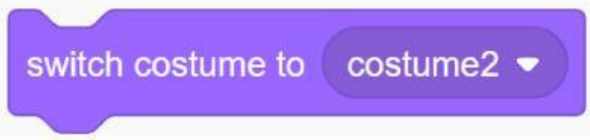

9.

10. 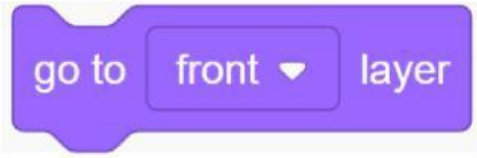

LIVEWORKSHEETS