At Home

1. Fill in the blanks.

(a)

The kettle bell has a mass of ____ kg.

(b)



The blender has a mass of ____ kg.

(c)

The snow globe has a mass of ____ g.

(d)



The toy robot has a mass of ____ g.

matholia
Copyright © 2024 Blue Ring Education
LIVEWORKSHEETS

3. The liquid in each container was poured into 1-liter beakers. Find the volume of liquid from each container.

(a)

(b)

(c)

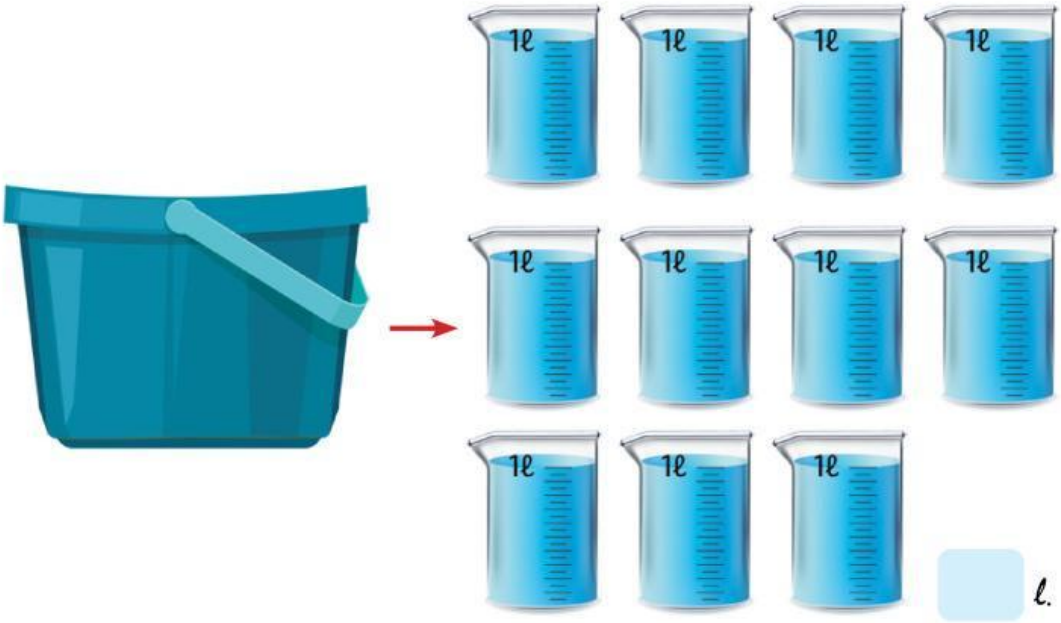

matholia

Copyright © 2024 Blue Ring Education

LIVEWORKSHEETS

4. Check to describe the volume of liquid in each container.

(a) Large bottle of sports drink

less than 1 ℓ ☐

more than 1 ℓ ☐

about 1 ℓ ☐

(b) Bath tub

less than 1 ℓ ☐

more than 1 ℓ ☐

about 1 ℓ ☐

(c) Small packet of ketchup

less than 1 ℓ ☐

more than 1 ℓ ☐

about 1 ℓ ☐

(d) Perfume bottle

less than 1 ℓ ☐

more than 1 ℓ ☐

about 1 ℓ ☐

Copyright © 2024 Blue Ring Education

LIVEWORKSHEETS

Solve It!

1. Find the volume of water in each container.

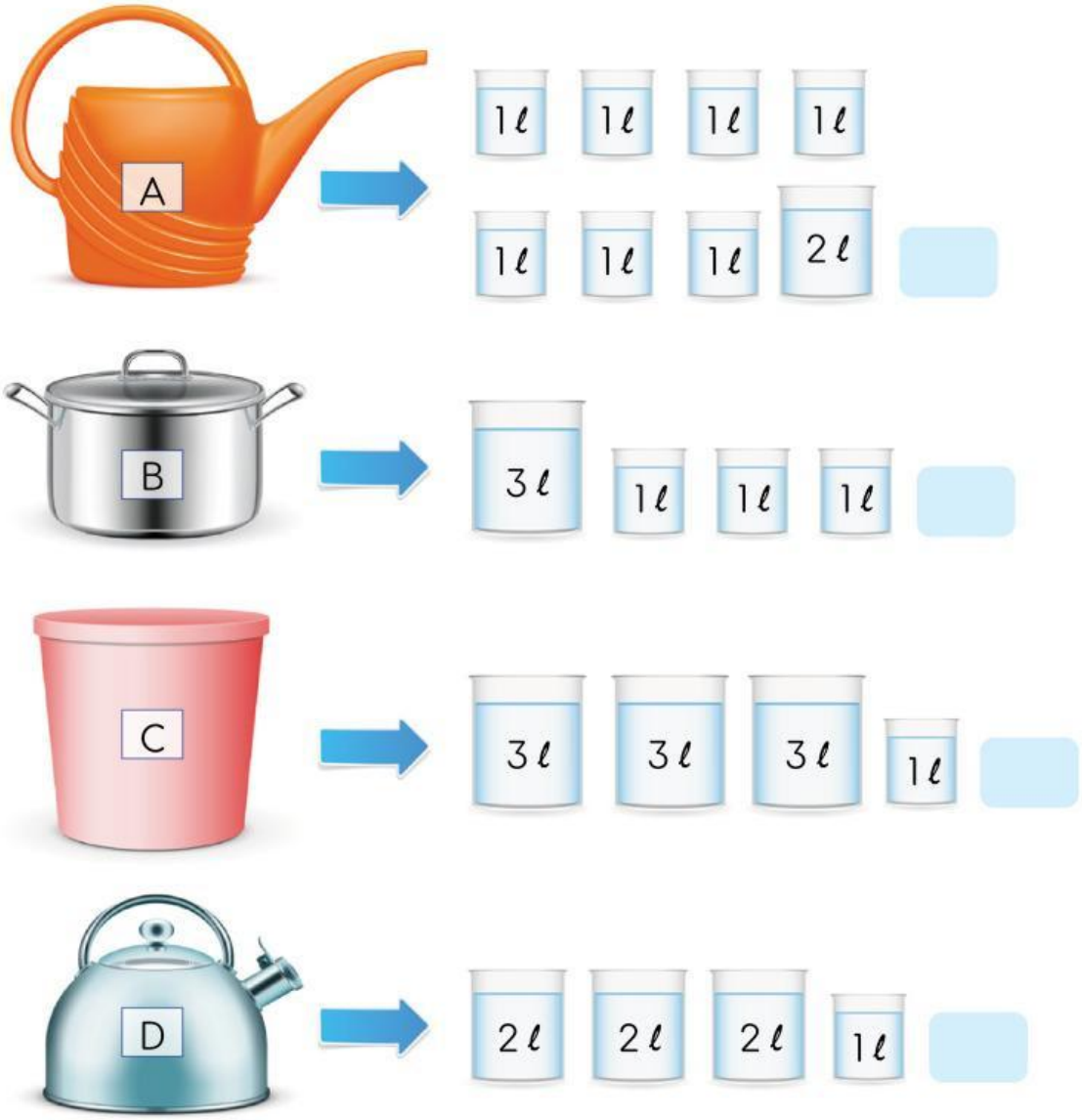

2. Arrange the containers from the smallest volume to the greatest volume.

smallest greatest

Copyright © 2024 Blue Ring Education
LIVEWORKSHEETS

3. The liquid in each container was poured into 1-liter beakers. Find the volume of liquid from each container.

(a)



ℓ

(b)

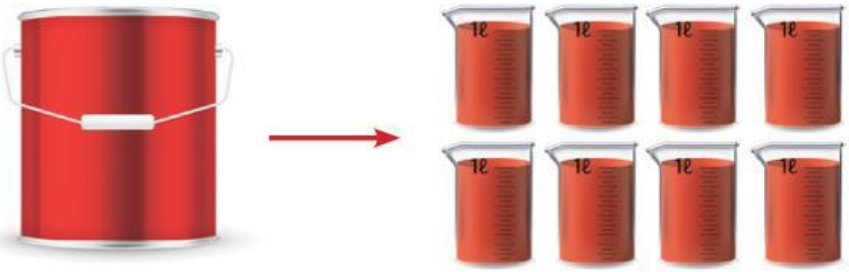

ℓ

(c)

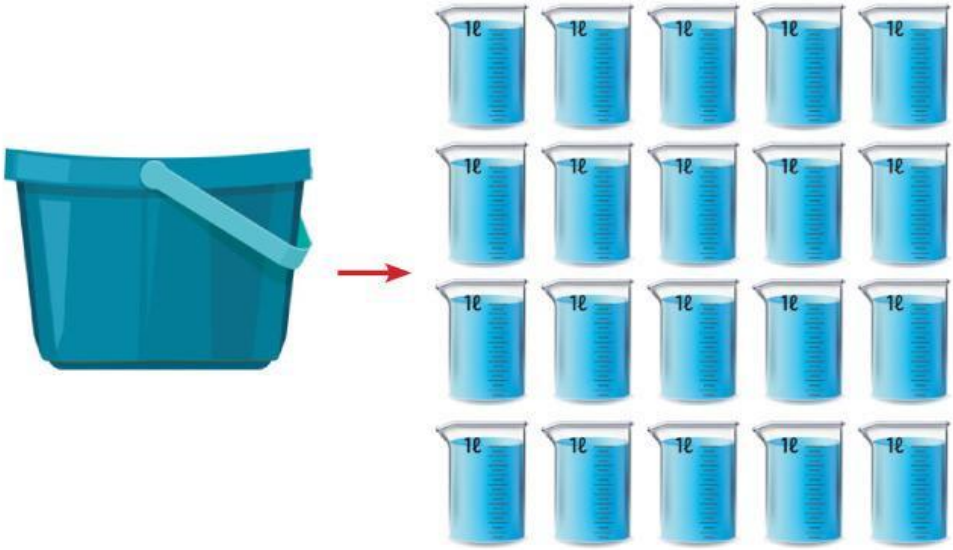

ℓ

Copyright © 2024 Blue Ring Education

LIVEWORKSHEETS

4. Check to describe the volume of liquid in each container.

(a) Bottle of hand wash

less than 1 ℓ ☐

more than 1 ℓ ☐

about 1 ℓ ☐

(b) Water cooler bottle

less than 1 ℓ ☐

more than 1 ℓ ☐

about 1 ℓ ☐

(c) Cup of tea

less than 1 ℓ ☐

more than 1 ℓ ☐

about 1 ℓ ☐

(d) Bottle of eye drops

less than 1 ℓ ☐

more than 1 ℓ ☐

about 1 ℓ ☐

matholia

Copyright © 2024 Blue Ring Education

LIVEWORKSHEETS