Nama : Kelas :

POLA GAMBAR BERULANG

Perhatikan bentuk geometri, pindahkan pola gambar berulang yang sesuai.

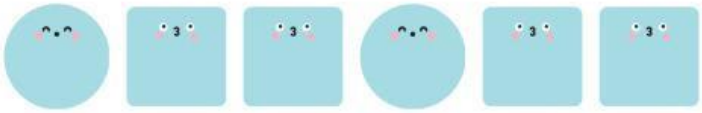

_____ _____

_____ _____

_____ _____

_____ _____



_____ _____

Pindahkan pola di bawah ini!



LIVEWORKSHEETS

POLA BILANGAN

Lengkapilah pola bilangan di bawah ini.

1 3 ___ 7 ___

2 ___ 6 ___ ___

3 6 9 ___ ___

5 ___ 15 20 ___

24 ___ 16 ___ 8 4

100 90 ___ 70 ___ ___

LIVEWORKSHEETS

POLA BILANGAN

Lengkapilah pola bilangan di bawah ini.

1. 2 4 6 ____ ____ ____

2. 1 4 7 ____ ____ ____

3. 3 6 9 ____ ____ ____

4. 1 ____ ____ 7 ____ ____

5. 5 10 ____ ____ ____ ____

LIVEWORKSHEETS