Lembar Kerja Peserta Didik

LKPD

PERUBAHAN WUJUD ZAT

NAMA : .....

KELAS : .....



LIVEWORKSHEETS

Lembar Kerja Peserta Didik

PERUBAHAN WUJUD ZAT

Tulislah perubahan wujud zat yang terjadi pada setiap nomor ke dalam kotak yang tersedia!

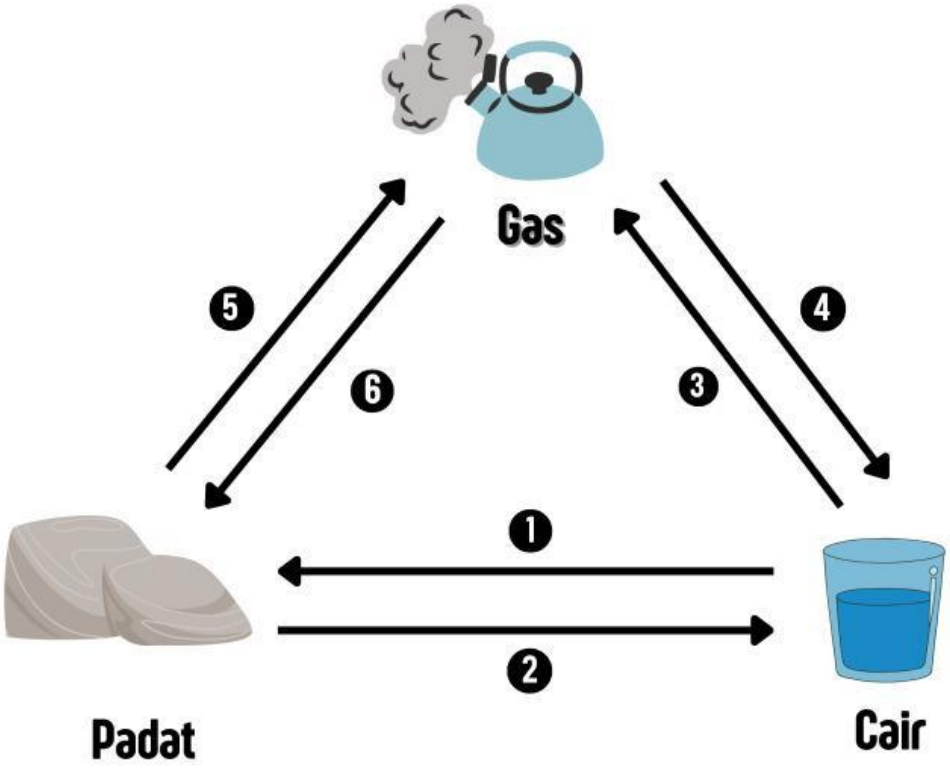

1.
2.
3.
4.
5.
6.

LIVEWORKSHEETS

Lembar Kerja Peserta Didik

PERUBAHAN WUJUD ZAT

Kelompokkan benda-benda berikut ini sesuai dengan wujudnya

Padat	
Cair	
Gas	



LIVEWORKSHEETS

Lembar Kerja Peserta Didik

PERUBAHAN WUJUD ZAT

Hubungkan gambar perubahan wujud benda di bawah ini dengan namanya!

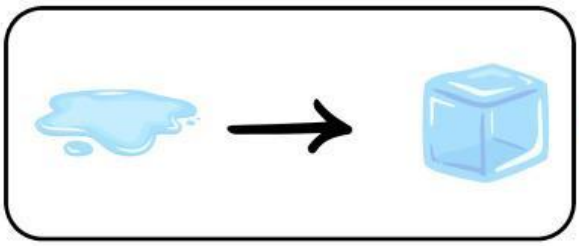

- Mengembun

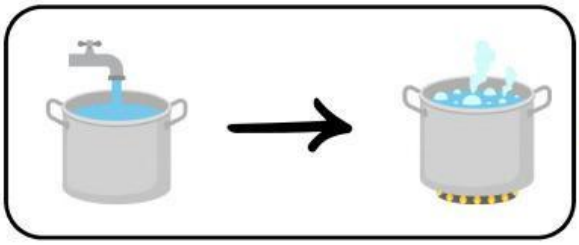

- Mencair

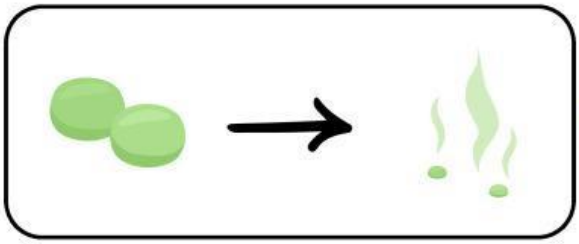

- Membeku

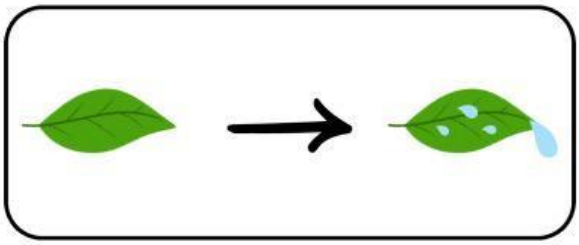

- Menyublim

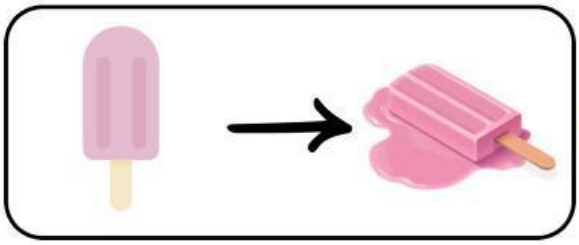

- Menguap

LIVEWORKSHEETS