Lambang Bilangan

Pasangkan lambang bilangan dengan nama bilangan yang tepat

45	Negatif sembilan puluh delapan
-98	Seratus tujuh
-897	Negatif delapan ratus sembilan puluh tujuh
56	Lima puluh tiga
-76	Enam puluh
107	Negatif seratus sembilan
-109	Empat puluh lima
1.453	Lima puluh enam
53	Seribu empat ratus lima puluh tiga
31	Tiga puluh satu
60	Negatif tujuh puluh enam

LIVEWORKSHEETS

Garis Bilangan

Lengkapi Garis Bilangan Berikut!

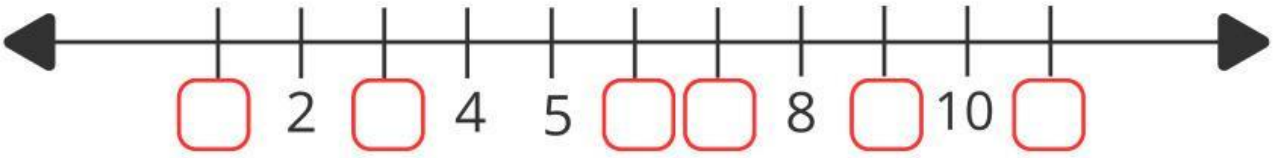

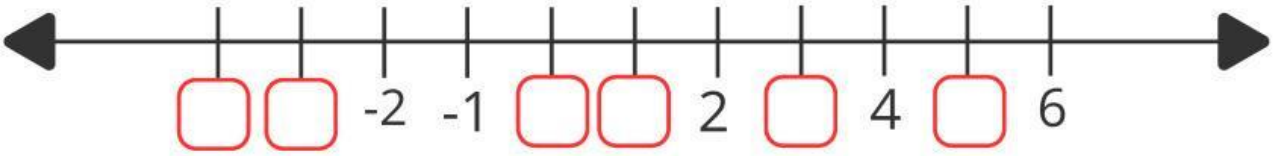

Lengkapi Penjumlahan pada Garis Bilangan Berikut!

1 + 2 = 3

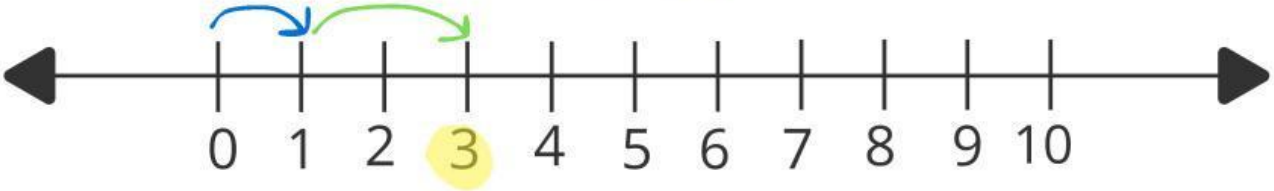

6 + 4 = ☐

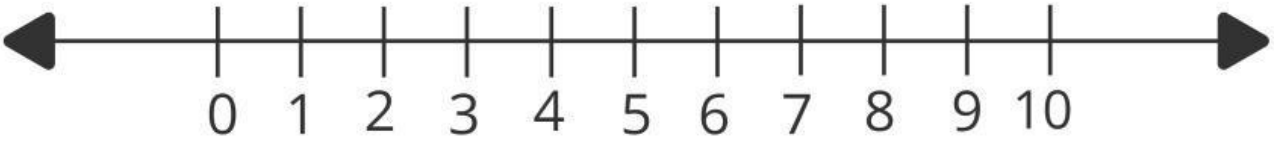

8 - 4 = ☐

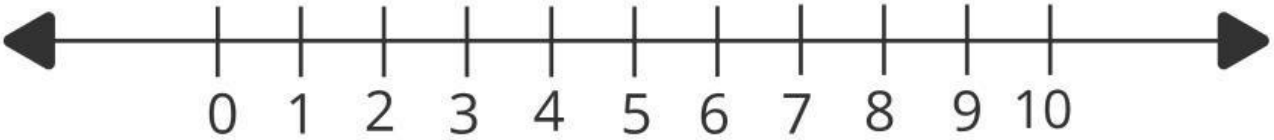

LIVEWORKSHEETS

Perkalian Bilangan Bulat

Kerjakan hasil perkalian berikut ini menggunakan penjumlahan berulang.

3 x 5	=	5 + 5 + 5	=	15
7 x 4	=		=	
8 x 1	=		=	
4 x 3	=		=	
5 x 5	=		=	
2 x (-3)	=	(-3) + (-3)	=	-6
3 x (-3)	=		=	
4 x 8	=		=	
1 x 9	=		=	
2 x 7	=		=	

LIVEWORKSHEETS

FPB & KPK

Isilah bagian yang kosong dengan cara melakukan perkalaian angka pada lingkaran dan menghasilkan angka di dalam toples.

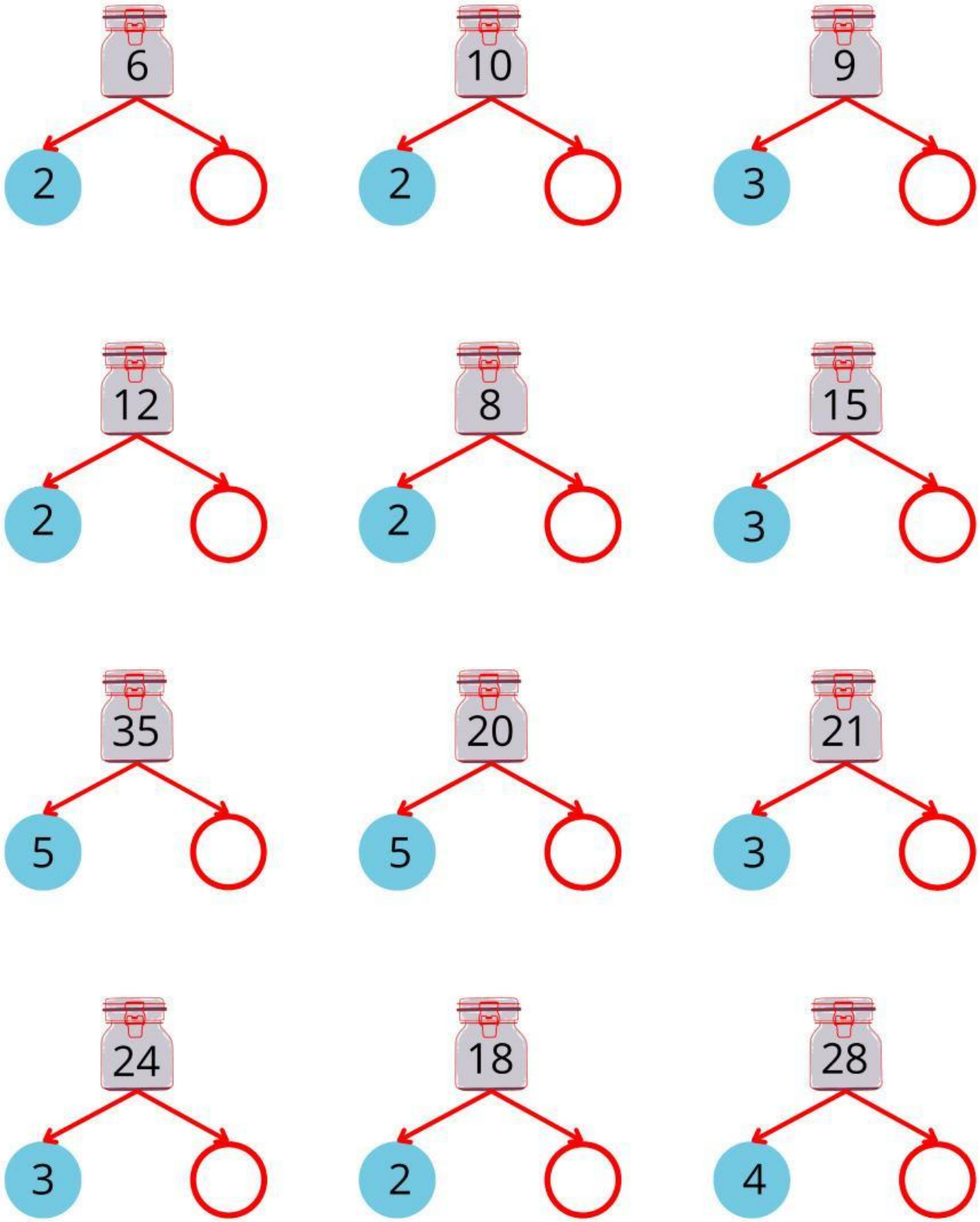

LIVEWORKSHEETS

Pohon Faktor

Lengkapi pohon faktor berikut

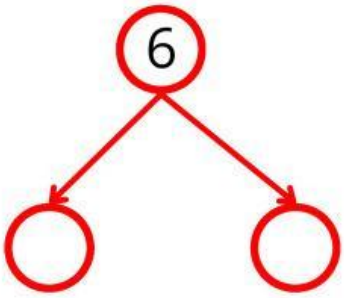

6 = ... x ...

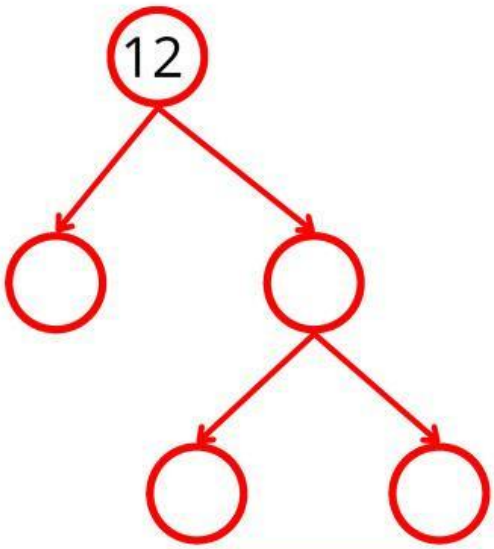

12 = ... x ... x ...

12 = ... ^{2} x ...

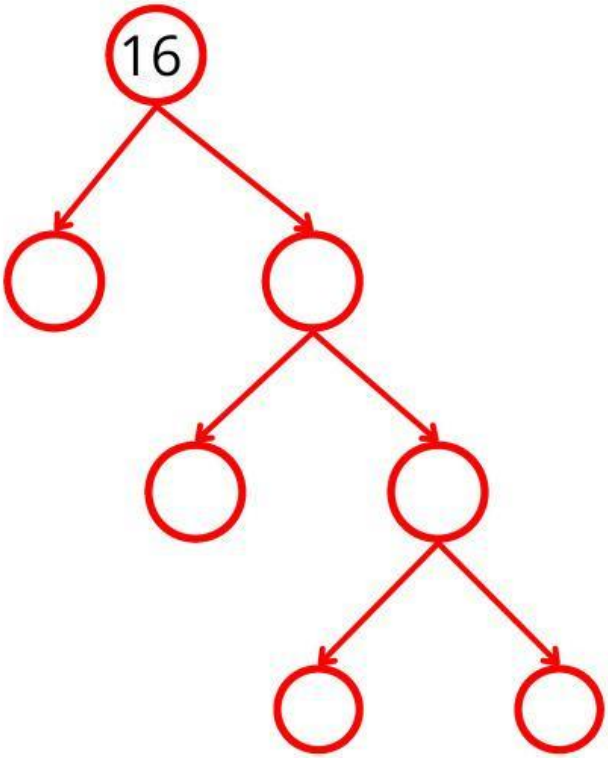

16 =

16 =

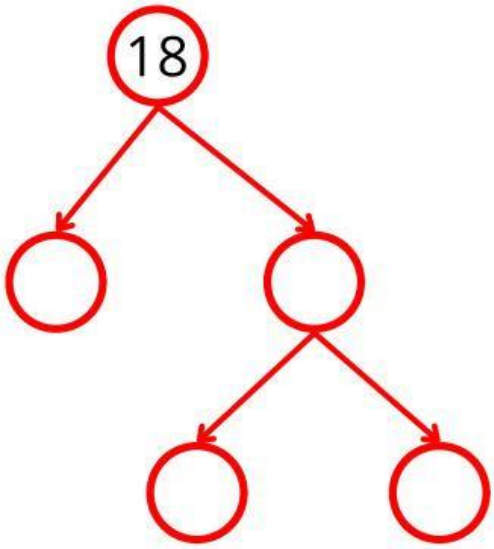

18 =

18 =

LIVEWORKSHEETS