SISTEM ESKRESI PADA MANUSIA

GINJAL

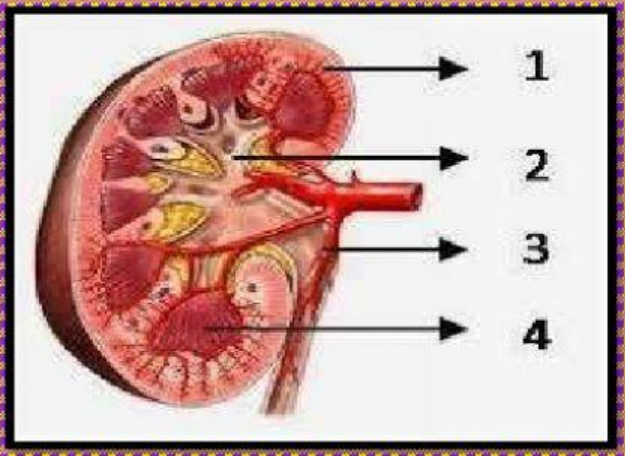

Gambar 1

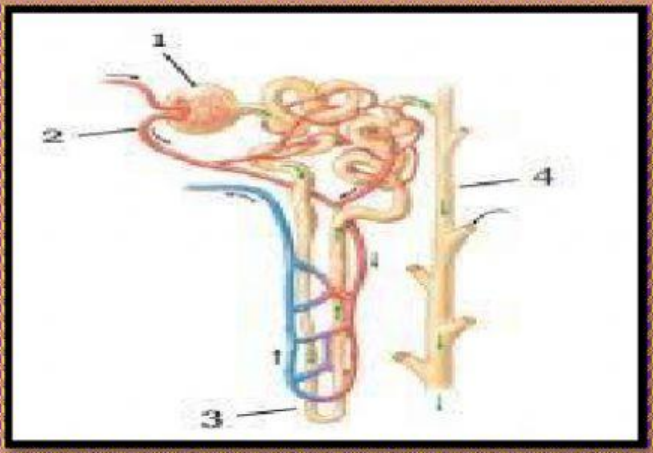

Gambar 2

BUATLAH KETERANGAN GAMBAR SESUAI DENGAN NOMORNYA

1	
2	
3	
4	

1	
2	
3	
4	

Yetty Darwis

LIVEWORKSHEETS

TARIK GARIS DARI NOMOR (1 - 5) ATAU HURUF (P – S) KE JAWABAN YANG DI ANGGAP BENAR DI SAMPINGNYA

KULIT

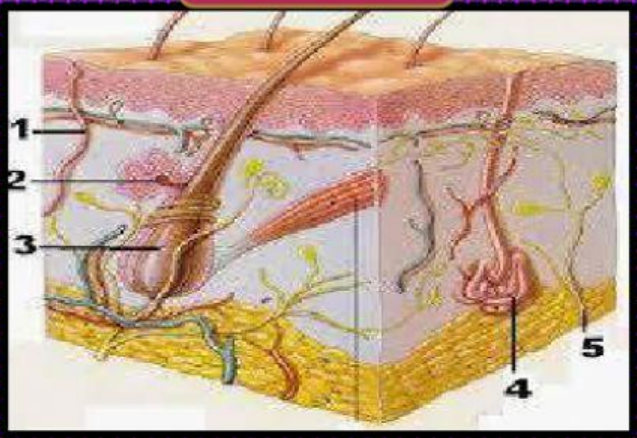

1	JARINGAN SYARAF
2	AKAR RAMBUT
3	PEMBULUH DARAH
4	KELENJER MINYAK
5	KELENJER KERINGAT

HATI

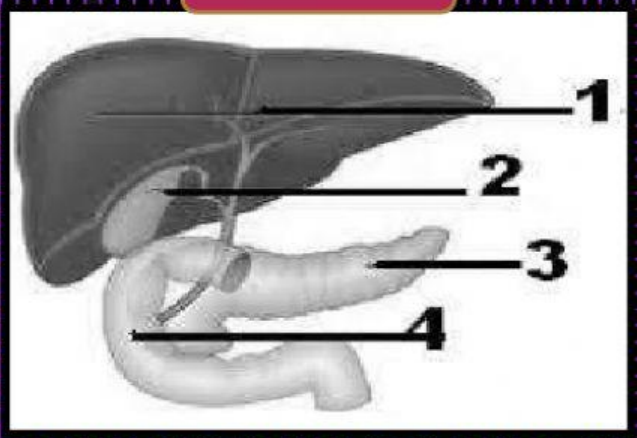

1	PANGKREAS
2	USUS HALUS
3	KANTONG EMPEDU
4	HATI

PARU-PARU

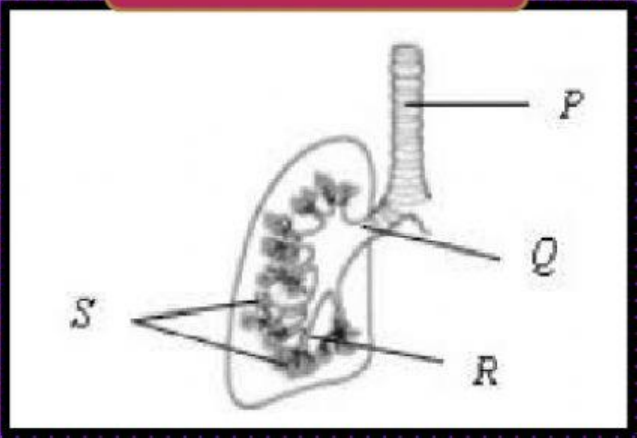

P	PARU-PARU
Q	BRONKUS
R	TRAKEA
S	BRONKHIOLUS

Yetty Darwis

LIVEWORKSHEETS