Ejercicios de Geometría

1. Halla el área coloreada de las siguientes figuras (aproxima con dos decimales):

a)

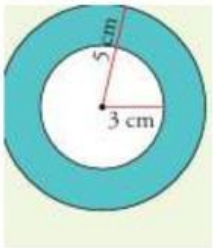

Área:

b)

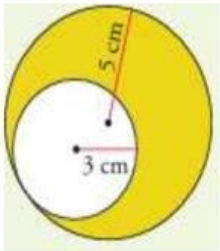

Área:

c)

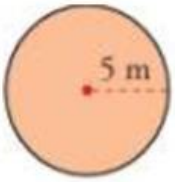

Área:

d)

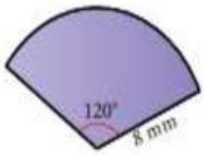

Área:

e)

Área:

f)

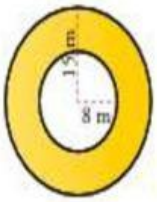

Área:

LIVEWORKSHEETS

2. Calcula el área y el perímetro de las siguientes figuras:

a)

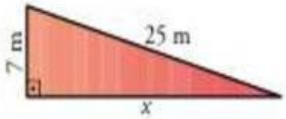

Área:

Perímetro:

b)

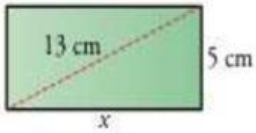

Área:

Perímetro:

c)

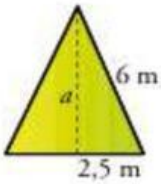

Área:

Perímetro:

d)

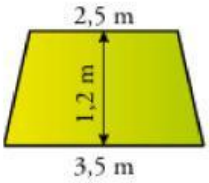

Área:

Perímetro:

3. Al atardecer, un árbol proyecta una sombra de 2,5 metros de longitud. Si la distancia desde la parte más alta del árbol al extremo más alejado de la sombra es de 4 metros, ¿cuál es la altura del árbol?

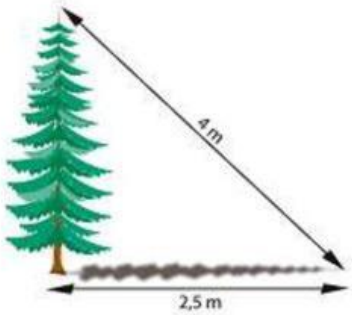

Altura:

LIVEWORKSHEETS