Nama : .....

Kelas : .....

Mengenal Bangun Datar segi empat

Hubungkan gambar dengan nama yang sesuai!





PERSEGI PANJANG

BELAH KETUPAT

PERSEGI

JAJAR GENJANG

LIVEWORKSHEETS

Nama : .....

Kelas : .....

Mengenal Bangun Datar segi empat

Beri nama pada kolom sesuai nama bangun datar







LIVEWORKSHEETS

Nama : .....

Kelas : .....

Mengenal Bangun Datar segi empat

Sebuah persegi memiliki panjang sisi 6 cm.
Hitunglah Keliling persegi tersebut!

6 cm

Jawaban :

LIVEWORKSHEETS