LKPD
BANGUN DATAR





Susunlah bangun datar diatas menjadi suatu bentuk!

LIVEWORKSHEETS

LKPD
BANGUN DATAR

1. Beri nama yang sesuai bangun datar di bawah ini!

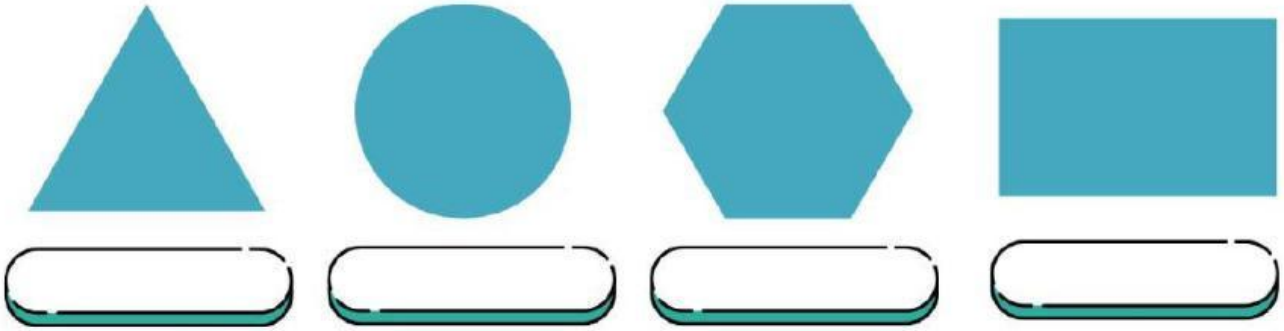

2. Manakah yang termasuk Segi Banyak?

3. Cocokkan Bangun Datar yang sesuai dengan Benda-benda berikut!

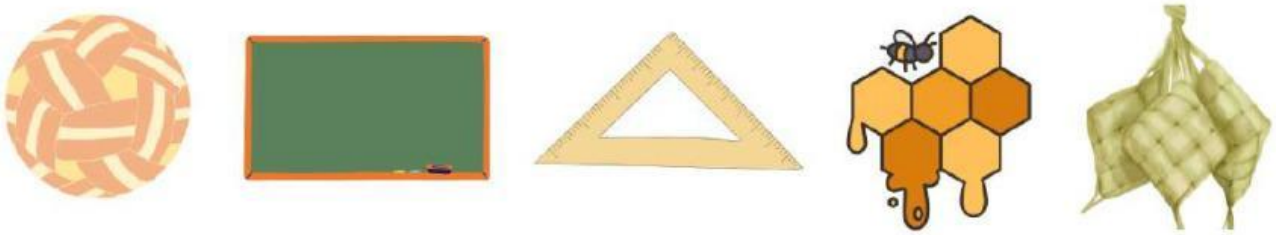

LIVEWORKSHEETS